Név:

ISMÉTLŐ FELADATLAP

1. Kösd össze a számokat a megfelelő képekkel!

1

2



3

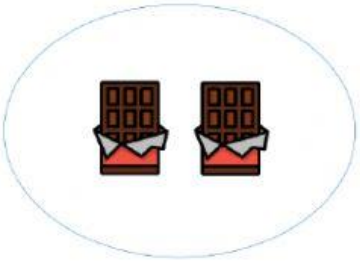

4

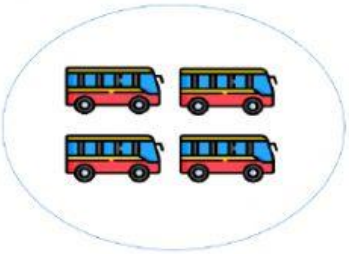

5

2. Írd be a számok szomszédait! Bal felől a kisebb szomszéd legyen!

	1	
	2	
	3	
	4	
	5	

3. Tedd növekvő sorrendbe a számokat!

4 2 5 3 1

4. Tedd ki a megfelelő kacsacsőrt!

1

2

3



2



2 ☐ 4

5 ☐ 3