❶ Cuenta, completa y escribe.



☐ decenas y ☐ unidades

☐ + ☐ = ☐

D	U

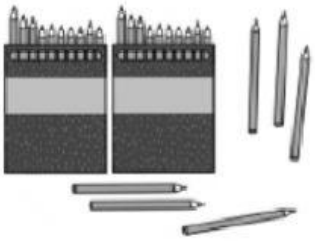

☐ decenas y ☐ unidades

☐ + ☐ = ☐

D	U

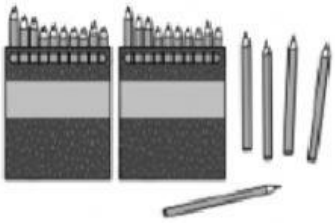

☐ decenas y ☐ unidades

☐ + ☐ = ☐

D	U

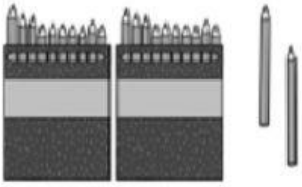

☐ decenas y ☐ unidades

☐ + ☐ = ☐

D	U

LIVEWORKSHEETS