Solve for the missing angle or x

Find the measure of the indicated angle in each triangle.

1)

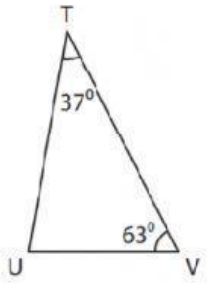

m∠U = _____

2)

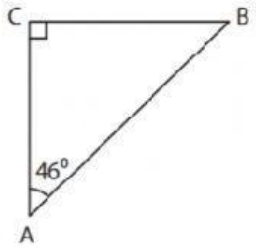

m∠B = _____

3)

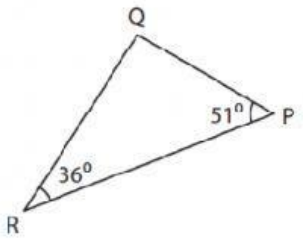

m∠Q = _____

Find the value of x in each triangle.

1)

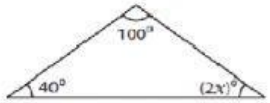

x = _____

2)

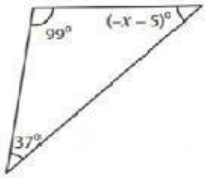

x = _____

3)

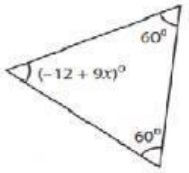

x = _____