Mathematics

Tens and Ones Twenty Family Numbers

Instructions: Type how many tens and ones.

A.

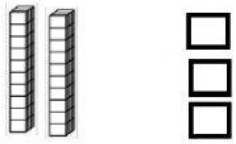

____tens _____ones = ____

B.

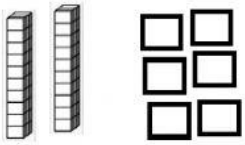

tens _____ones = ___

C.

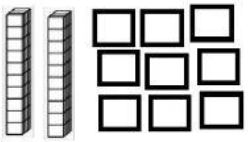

____tens _____ones = ___

D.

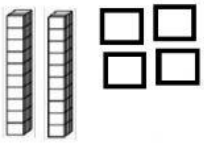

____tens _____ones = ___

E.

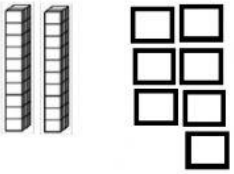

____tens _____ones = ___

F.

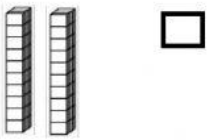

____tens _____ones = ___

G.

____tens _____ones = ___

H.

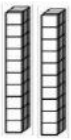

____tens _____ones = ___

I.

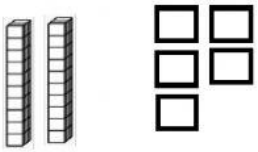

____tens _____ones = ___

J.

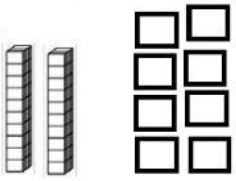

____tens _____ones = _____