Halving small numbers (5)

Find **half** of these numbers.
Write the answers in the boxes.



Half of 6 =



Half of 18 =

Half of 10 =



Half of 14 =

Half of 2 =

Page 1

a) 3 = _____

b) 5 = _____

c) 9 = _____

d) 13 = _____

e) 17 = _____

f) 23 = _____

g) 25 = _____

h) 43 = _____

i) 65 = _____

j) 51 = _____