Isilah jawaban pada titik-titik di bawah ini!

No.	Gambar Balok	panjang (p)	lebar (l)	tinggi (t)	Volume (V) p x l x t
1.		5	2	3	...
2.		...	...	...	...
3.		...	...	...	...
4.		...	...	...	...
5.	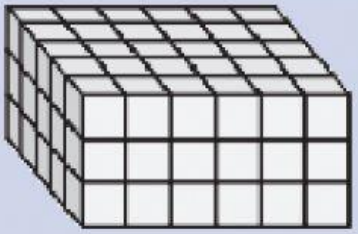	...	...	...	...

Mrs. Fitri Yanti
Guru SDS Yasporbi 1

No.	Gambar Balok	panjang (p)	lebar (l)	tinggi (t)	Volume (V) p x l x t
6.	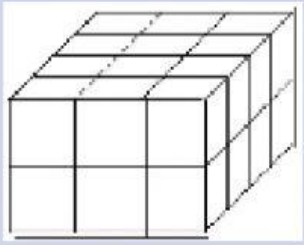	...	...	...	...
7.	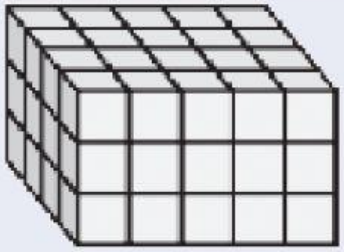	...	...	...	...
8.		...	...	...	...
9.		...	...	...	...
10.		...	...	...	...

Mrs. Fitri Yanti
Guru SDS Yasporbi 1