A practicar

1. Recordemos la equivalencia de los bloques multibase. Une con líneas sus respectivos valores



1 unidad	**100 unidades**	**10 unidades**

1. Escribe sobre las líneas las cantidades que se formen en cada caso. Suma las cantidades y arrastra el resultado al cuadro correspondiente.

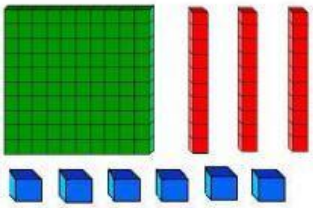

+

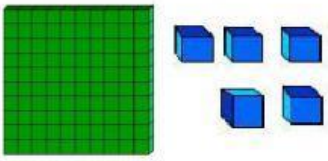

=

_____ _____

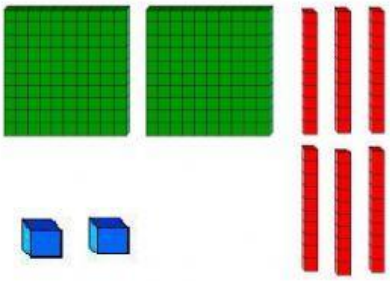

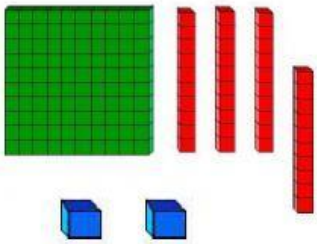

+ =

_____ _____

LIVEWORKSHEETS

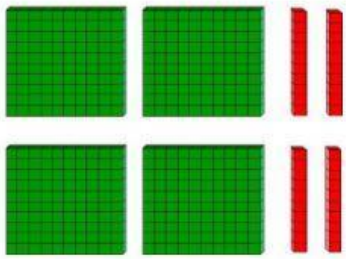

_____ + 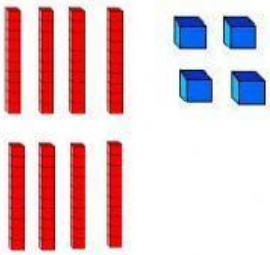 _____ = ☐

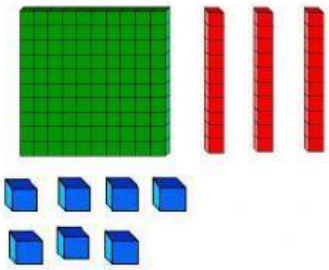

_____ + 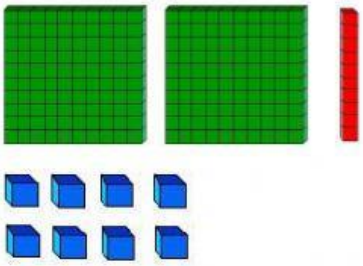 _____ = ☐

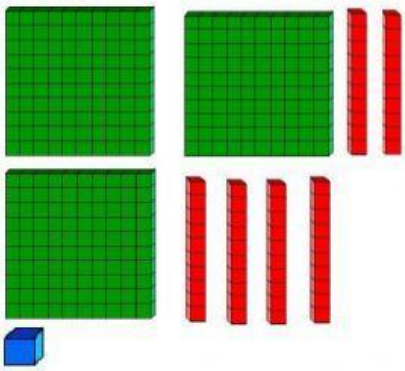

_____ + 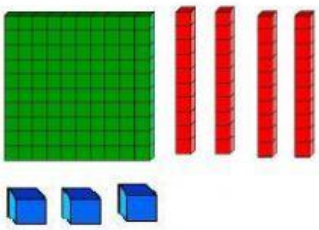 _____ = ☐

LIVEWORKSHEETS

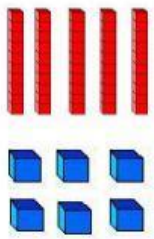

_____

+

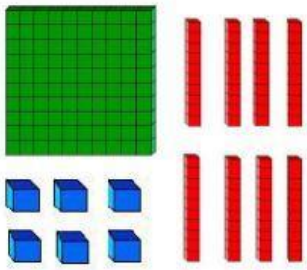

_____

=

524	241	355	242
404	504		

LIVEWORKSHEETS