Colegio Pequeños Bilingües
Fourth Term

Teacher Qca. Jaznemileth Grillo Garavito | Grado: Quinto Primary

FINAL EXAM

Name:_____

Date	Name of day	Month	Day number	Year	Score

1. Completa el siguiente cuadro:

$(n-2)180°$

Polygon	Name	# sides	# vertex	# internal angles
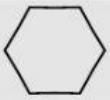				
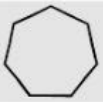				
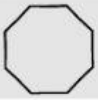				

Complete

- Nonagono o enneagon, have _____ sides and _____ vertex.
- Decagon, have _____ sides and _____ vertex.
- Undecagon, have _____ sides and _____ vertex.
- Dodecagon, have _____ sides and _____ vertex.
- Pentadecagon, have _____ sides and _____ vertex.
- Icosagono, have _____ sides and _____ vertex.

2. Calculate "x" and classify triangle ABC, according to length of its sides.

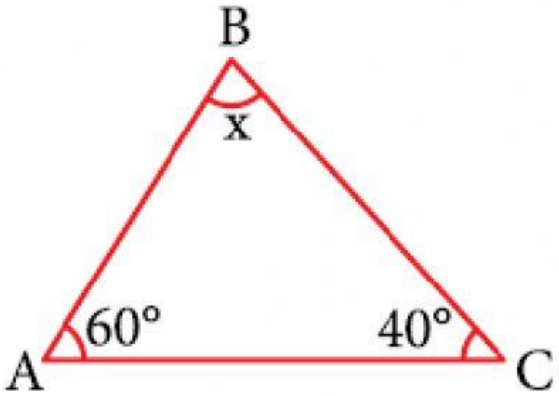

180° | 80° | 60° | 81°

3. If 80 stuffed animals cost S /. 650, how much will be paid for 40 of the same stuffed animals?

4. A es directamente proporcional a B complete el siguiente cuadro y calcule [X + Y]

A	20	40	X	80		
B	5		15	Y	25	50

Name the following types of polygons: Concave or convex?

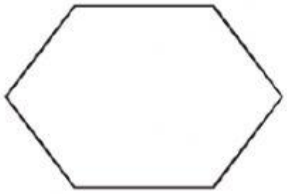

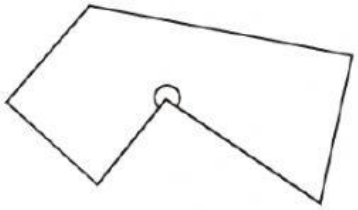

CALCULATE X

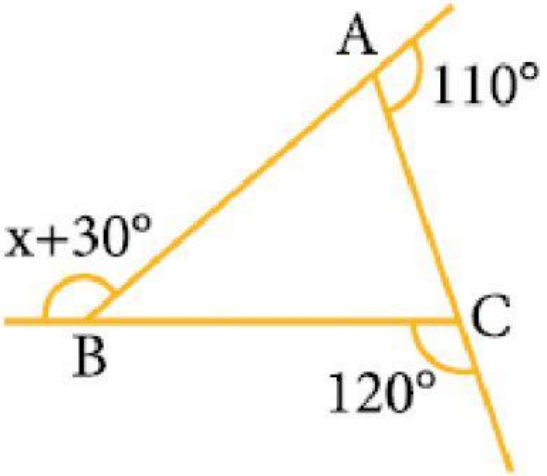

120° 100° 110° 360°