1. Write the numbers.

452 has a ____ in the ones' place.

918 has a ____ in the hundreds' place.

763 has a ____ in the tens' place.

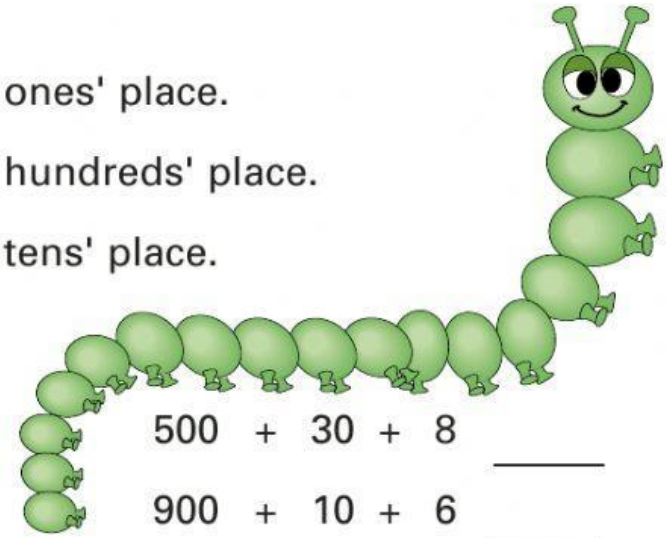

2. Write the numbers.

495 = ____ + ____ + ____

817 = ____ + ____ + ____

500 + 30 + 8 ____

900 + 10 + 6 ____

3. Write the correct time.

____ : ____

____ : ____

____ : ____

____ : ____

4. Write the value of each coin.

____ ¢

____ ¢

____ ¢

____ ¢

____ ¢

____ ¢

____ ¢

____ ¢



5. Add.

29	35	44	13	18	59	37	53
+33	+55	+29	+67	+33	+29	+87	+49
38	63	58	47	92	97	43	42
+88	+99	+42	+77	+19	+88	+27	+77

6. Write = or ≠ between each set.

3 + 7 ____ 10	7 + 9 ____ 16	5 + 9 ____ 13
4 + 9 ____ 12	5 + 3 ____ 9	6 + 8 ____ 14

7. Draw a line to match the shape to its name.

triangle

square

octagon

diamond

circle

oval

rectangle



8. Subtract.

11	16	17	12	15	13	11	13
- 9	- 8	- 7	- 6	- 8	- 7	- 3	- 6
12	14	17	11	15	13	18	16
- 5	- 8	- 8	- 4	- 7	- 4	- 9	- 8
68	99	72	33	78	55	57	78
-46	-35	-52	-20	-24	-43	-24	-27

9. Write the fractional part that is shaded.

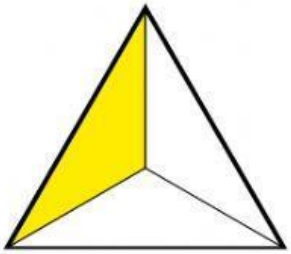

____

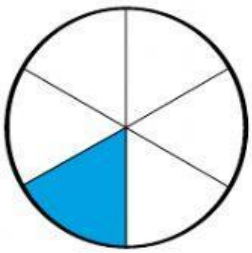

____



____



____

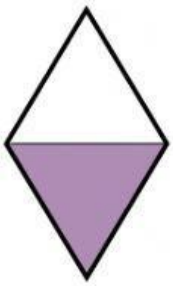

____



____

10. How many eggs are in a dozen? ____

11. Write < or > between each set.

135 ____ 144 116 ____ 173

173 ____ 167 183 ____ 200

12. Circle every third number after 7.

7	8	9	10	11	12	13	14	15
16	17	18	19	20	21	22	23	24
25	26	27	28	29	30	31	32	33

Write the circled numbers on the blanks.

____ ____ ____ ____ ____ ____ ____ ____ ____

13. Write the value of each set of coins.

____¢

____¢

____¢

____¢