Name: Kelas:

3D Shapes.

1. Name the 3-D shapes as described.

a. I vertex → I flat face → I curved face

b. 2 flat square faces → 8 vertices → 4 flat rectangular faces

2. Complete the number of basic shapes.

3-D shape	Name	Basic shape	Number
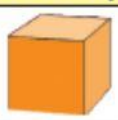	Cube		
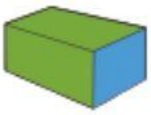	Cuboid		
	Pyramid		
	Cylinder		
	Cone		

3. Name the 3-D shape for each net below.

a 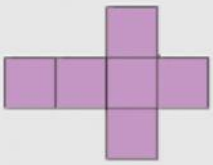

b 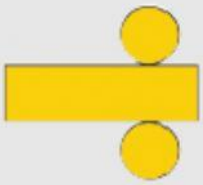

c 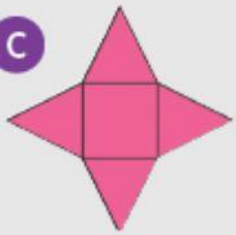

d

e

Source: Mt Textbbook Year 2

RS