How many?

There are 3 groups.

There are 2 in each group.

You can add.

2 + 2 + 2 = 6

You can multiply.

3 twos = 6

3 groups of 2 = 6

3 X 2 = 6



Add it: _____

4 twos = ____

____ x ____ = ____

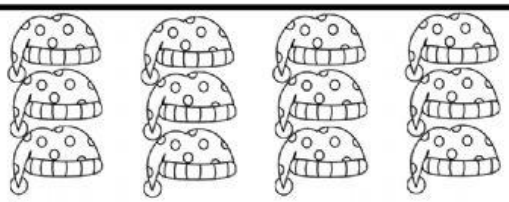

Add it: _____

_____ groups of _____

____ x ____ = ____



Add it: _____

5 twos = ____

____ x ____ = ____



Add it: _____

_____ groups of _____

____ x ____ = ____

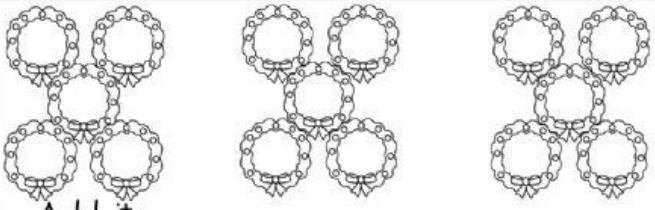

Add it: _____

_____ groups of _____

____ x ____ = ____

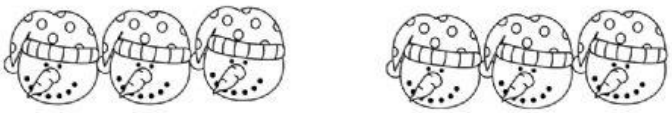

Add it: _____

2 threes = ____

____ x ____ = ____