JARINGAN HEWAN

NAMA :
KELAS :

1. Tentukanlah jenis epitel yang tepat sesuai dengan gambar berikut !



2. Jodohkanlah jaringan otot berikut sesuai dengan tempat melekatnya dengan tepat !

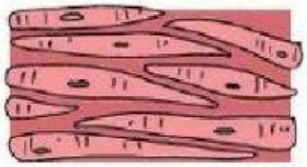

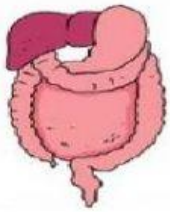

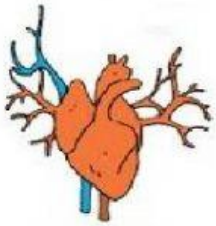

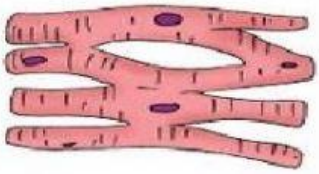

3. Tariklah nama bagian nama jaringan dan sel yang sesuai dengan gambar !

Gambar	Nama jaringan	Nama Sel

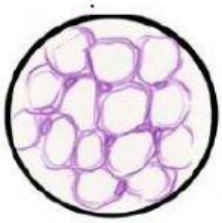

Adiposa | Tulang | Padat | Darah

Longgar | Lemak | Fibrosit | Osteosit

Eritrosit,Lukosit,Trombosit | Fibrosit