Οι κλασματικές μονάδες

1. Γράψε με κλάσμα και με λέξεις το χρωματισμένο μέρος κάθε επιφάνειας.

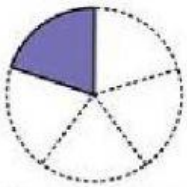

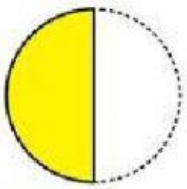

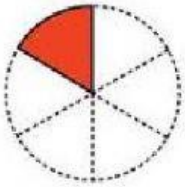

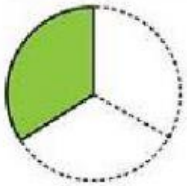

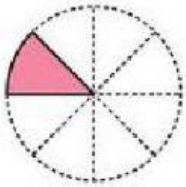

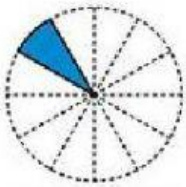

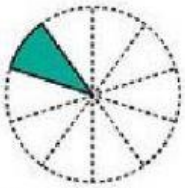

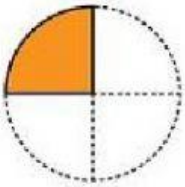

2. Γράψε με κλάσμα το χρωματισμένο μέρος κάθε επιφάνειας και ύστερα σύγκρινε τα κλάσματα μεταξύ τους. Ποια κλασματική μονάδα είναι μεγαλύτερη κάθε φορά;

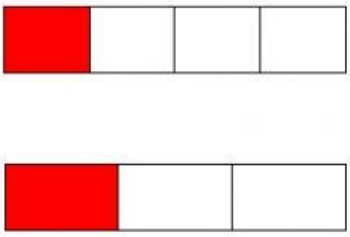

____

____

Συγκρίνω: ____ > ____

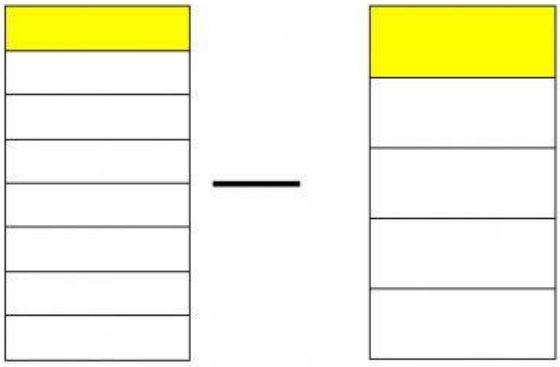

____

____

Συγκρίνω: ____ > ____

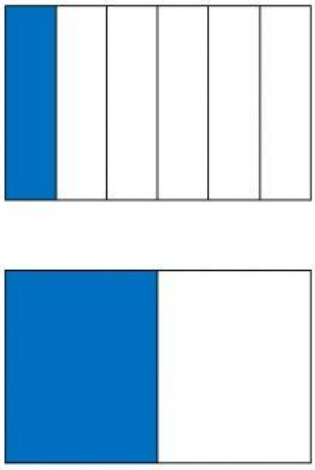

____

____

Συγκρίνω: ____ > ____