Guía de fracciones

1. Escribe cómo se leen las siguientes fracciones.

a.- $\frac{2}{4}$ _____

b.- $\frac{1}{3}$ _____

c.- $\frac{4}{8}$ _____

2. Escribe la fracción representada.



$\frac{\square}{\square}$

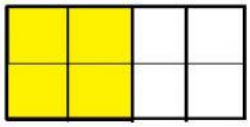

$\frac{\square}{\square}$

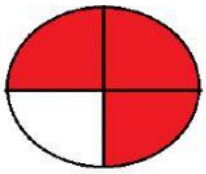

$\frac{\square}{\square}$



$\frac{\square}{\square}$

3. Adiciona las siguientes fracciones.

a) $\frac{2}{6} + \frac{1}{6} = \frac{\square}{\square}$

b) $\frac{3}{5} + \frac{2}{5} = \frac{\square}{\square}$

c) $\frac{4}{8} + \frac{1}{8} = \frac{\square}{\square}$

d) $\frac{4}{7} + \frac{1}{7} = \frac{\square}{\square}$

4. Sustrae las fracciones.

a) $\frac{8}{9} - \frac{4}{9} = \frac{\square}{\square}$

b) $\frac{2}{3} - \frac{1}{3} = \frac{\square}{\square}$

c) $\frac{4}{5} - \frac{2}{5} = \frac{\square}{\square}$

d) $\frac{6}{8} - \frac{4}{8} = \frac{\square}{\square}$