KEMAHIRAN PEMULIHAN : DARAB

BAHAGIAN 4

SILA LIHAT VIDEO DI BAWAH DAN JAWAB SOALAN DALAM HELAIAN SETERUSNYA.

H. Warnakan ayat matematik yang betul berdasarkan garis nombor berikut.

Contoh:

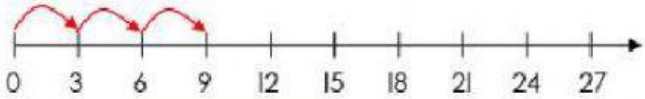

$3 \times 3 = 9$ | $6 \times 3 = 18$

1.

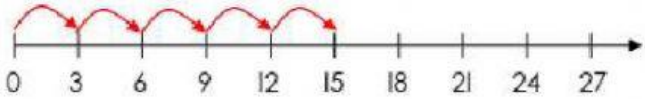

$2 \times 3 = 6$ | $5 \times 3 = 15$

2.

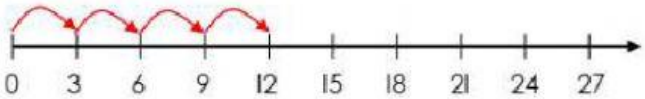

$4 \times 3 = 12$ | $7 \times 3 = 21$

3.

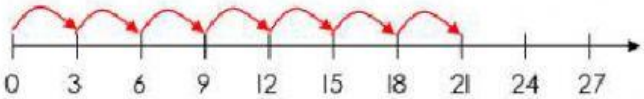

$9 \times 3 = 27$ | $7 \times 3 = 21$

4.

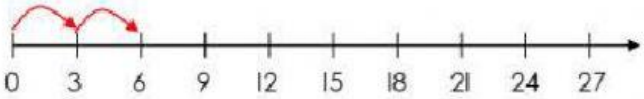

$2 \times 3 = 6$ | $9 \times 3 = 27$

1. Lengkapkan ayat matematik berdasarkan garis nombor berikut.

Contoh:

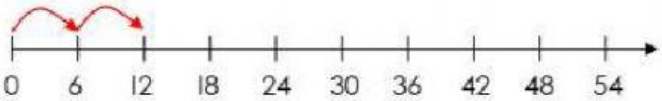

6 + 6 = 12

2 × 6 = 12

1.



☐ + ☐ + ☐ + ☐ = ☐

☐ × 6 = ☐

2.

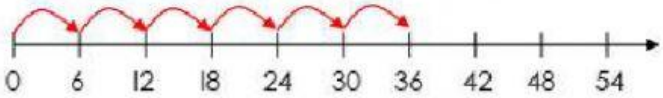

☐ + ☐ + ☐ + ☐ + ☐ + ☐ = ☐

☐ × ☐ = ☐

3.

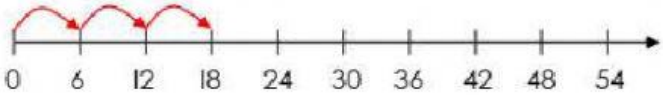

☐ + ☐ + ☐ = ☐

☐ × 6 = ☐

J. Lengkapkan ayat matematik berdasarkan garis nombor berikut.

Contoh:

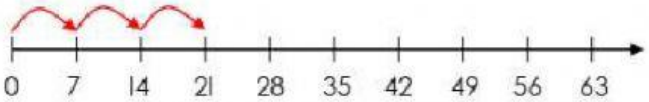

$\boxed{7} + \boxed{7} + \boxed{7} = \boxed{21}$

$\boxed{3} \times \boxed{7} = \boxed{21}$

1.

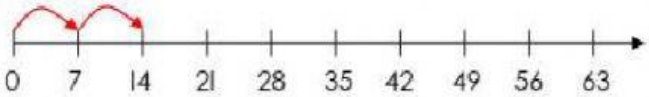

$\boxed{} + \boxed{} = \boxed{}$

$\boxed{} \times \boxed{} = \boxed{}$

2.

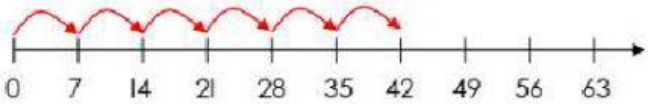

$\boxed{} + \boxed{} + \boxed{} + \boxed{} + \boxed{} + \boxed{} = \boxed{}$

$\boxed{} \times \boxed{} = \boxed{}$

3.

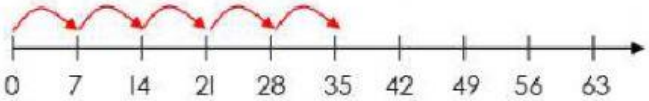

$\boxed{} + \boxed{} + \boxed{} + \boxed{} + \boxed{} = \boxed{}$

$\boxed{} \times \boxed{} = \boxed{}$

K. Lengkapkan ayat matematik berdasarkan garis nombor berikut.

Contoh:

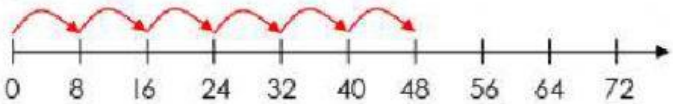

8 + 8 + 8 + 8 + 8 + 8 = 48

6 × 8 = 48

1.

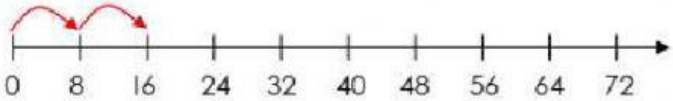

☐ + ☐ = ☐

☐ × ☐ = ☐

2.

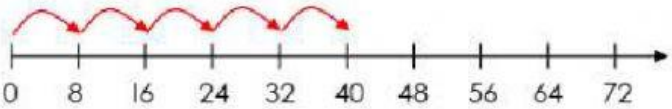

☐ + ☐ + ☐ + ☐ + ☐ = ☐

☐ × ☐ = ☐

3.

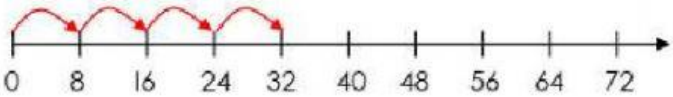

☐ + ☐ + ☐ + ☐ = ☐

☐ × ☐ = ☐

L. Lengkapkan ayat matematik berdasarkan garis nombor berikut.

Contoh:

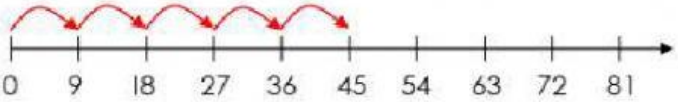

9 + 9 + 9 + 9 + 9 = 45

5 × 9 = 45

1.

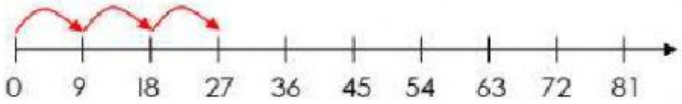

☐ + ☐ + ☐ = ☐

☐ × ☐ = ☐

2.

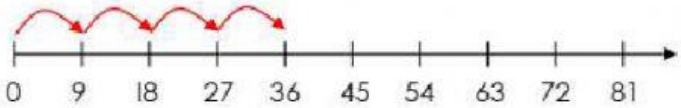

☐ + ☐ + ☐ + ☐ = ☐

☐ × ☐ = ☐

3.

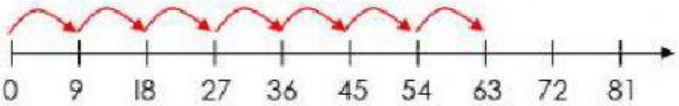

☐ + ☐ + ☐ + ☐ + ☐ + ☐ + ☐ = ☐

☐ × ☐ = ☐

N. Lengkapkan ayat matematik berdasarkan garis nombor berikut.

Contoh:

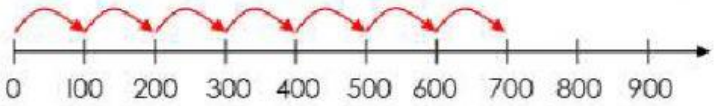

$7 \times 100 = 700$

1.

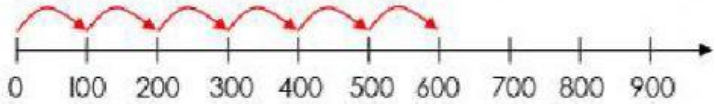

2.

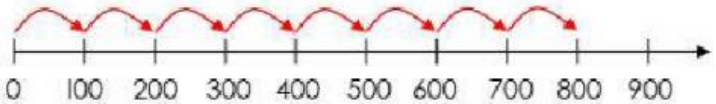

3.

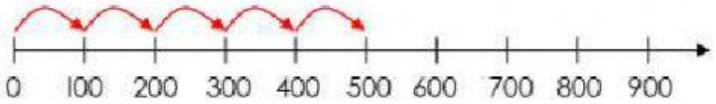
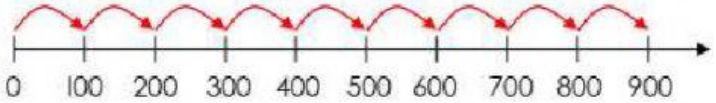
4.