TUGASAN SAINS KHAMIS, 10.12.2020

1. Lengkapkan peta pokok di bawah dengan tabiat pemakanan haiwan berikut.

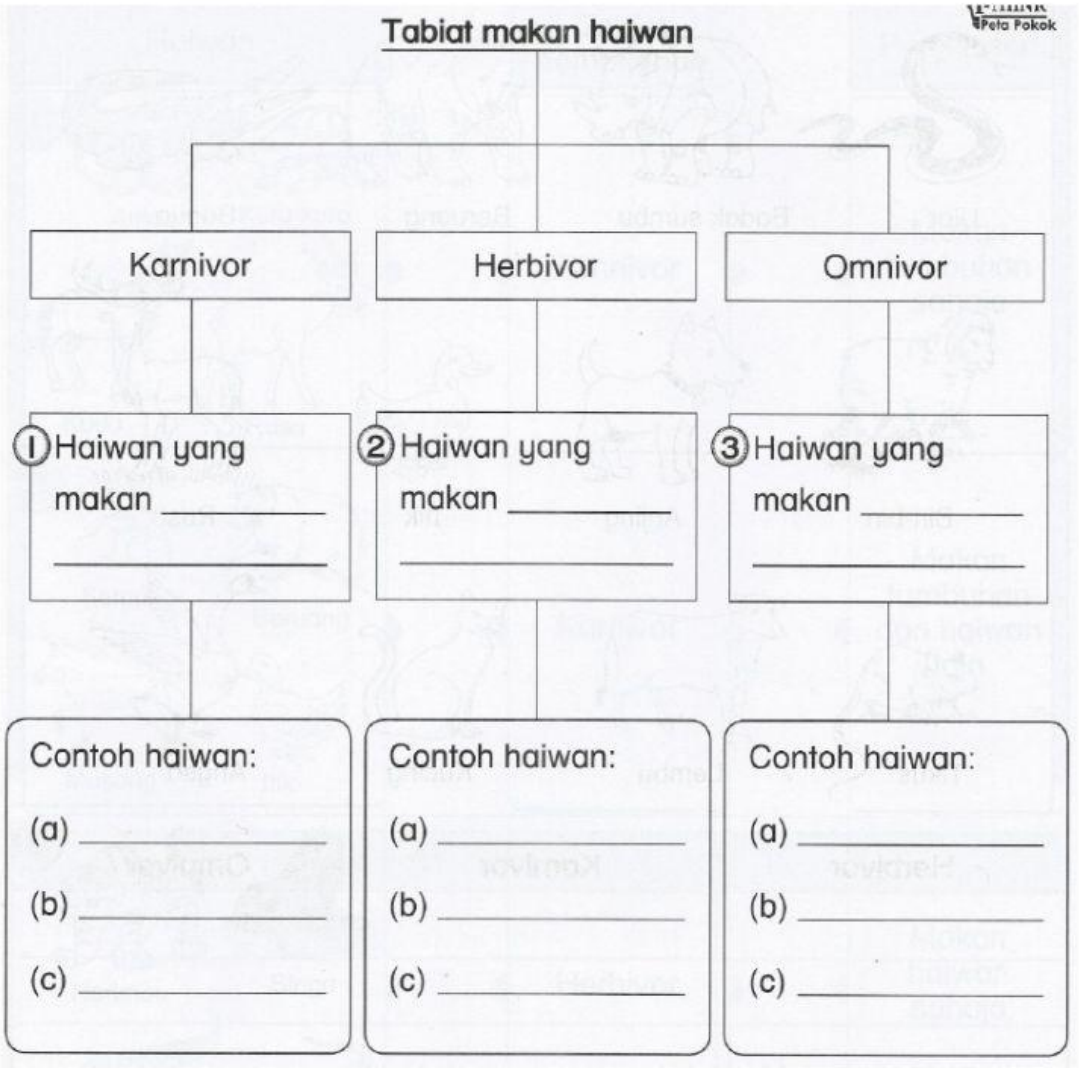

Tikus	Helang	Serigala	Beruang koala
Beruang	Gajah	Ayam	Buaya
Haiwan sahaja	Tumbuhan sahaja	Haiwan dan tumbuhan	Arnab

2. Kelaskan haiwan-haiwan berikut ke dalam kumpulan yang betul.



Herbivor	Karnivor	Omnivor

3. Leretkan jawapan ke dalam kotak yang betul.

Haiwan	Tablat pemakanan	Penjelasan
1 		
2 		
3 		

Omnivor	Makan tumbuhan sahaja	Herbivor
Makan tumbuhan dan haiwan	karnivor	Makan haiwan sahaja