MATEMATIK TAHUN 1

NAMA: _____ KELAS: _____

Tuliskan objek berikut sama ada panjang, pendek, tinggi, atau rendah.

Segulung tali

Kucing

Pokok kelapa

Bangunan

pensel

Tali skip

Berus gigi

Reben

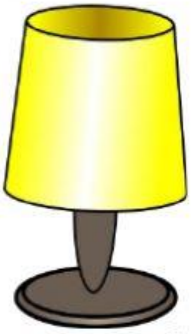

Lampu meja

Koleksi Latihan Cikgu CTZubaidah

MATEMATIK TAHUN 1

NAMA: _____ KELAS: _____

Isi jawapan dengan jawapan yang betul.



Panjang pembaris sama dengan

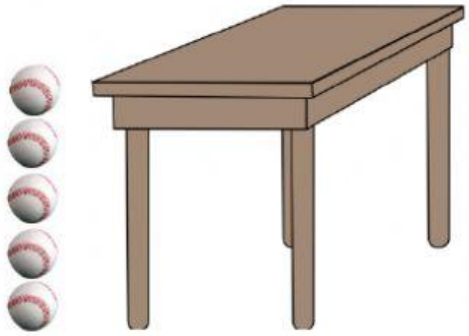

Tinggi meja sama dengan

Tinggi pasu sama dengan



Panjang paku sama dengan

Padankan.

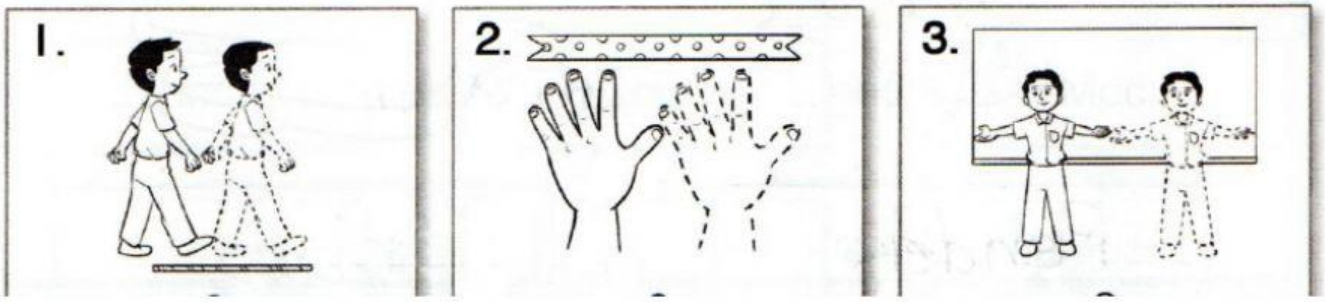

2 depa

2 langkah

2 jengkal

Koleksi Latihan Cikgu CTZubaidah