ΟΝΟΜΑ:_____ ΗΜΕΡΟΜΗΝΙΑ:_____

Κλάσματα και κλασματικές μονάδες

1. Επίλεξε την εικόνα που δείχνει σωστά το κλάσμα:

$\frac{2}{4}$

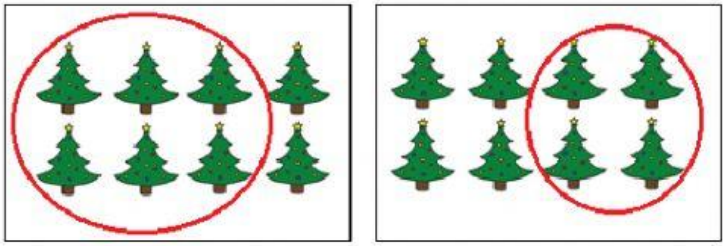

$\frac{2}{3}$

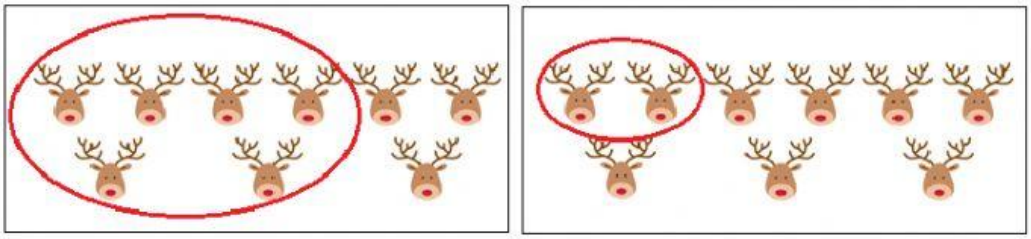

$\frac{1}{2}$



$\frac{1}{3}$



2. Επίλεξε <u>μόνο</u> τις κλασματικές μονάδες:

$\frac{1}{3}$ $\frac{1}{8}$ $\frac{1}{7}$ $\frac{1}{20}$ $\frac{7}{8}$

$\frac{3}{4}$ $\frac{2}{5}$

$\frac{5}{9}$ $\frac{1}{10}$ $\frac{4}{6}$ $\frac{1}{15}$