1. Relie

5 heures 35 minutes

22 heures 10 minutes

17 heures 50 minutes

10 heures 15 minutes

9 heures 20 minutes

16 heures 5 minutes

2. Ecris l'heure du matin.

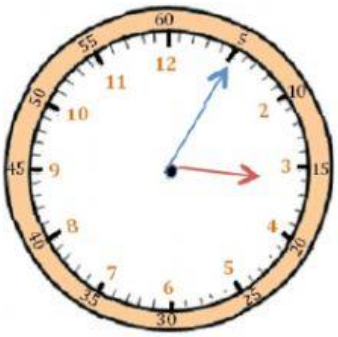

Il est ____ h et ____min.

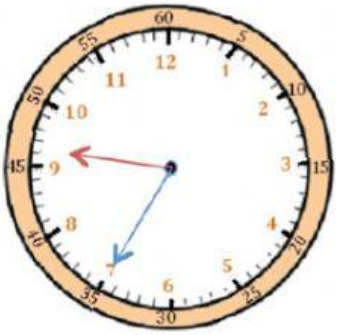

Il est ____ h et ____min.

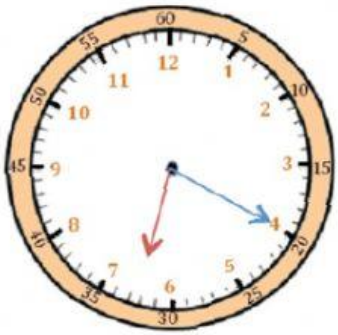

Il est ____ h et ____min

3. Ecris l'heure du soir ou de l'après-midi.

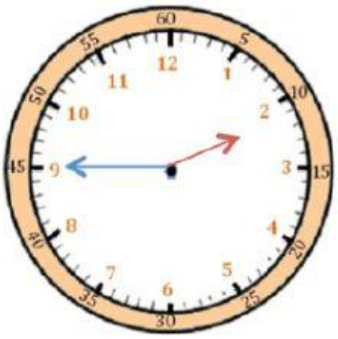

Il est ____ h et ____min.

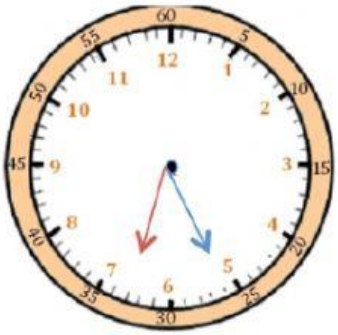

Il est ____ h et ____min.

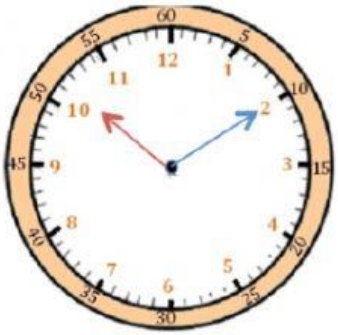

Il est ____ h et ____min.

4. Sélectionne la ou les bonnes réponses.

	16 h 45 min
	15 h 45 min
	17 h 15 min

	18 h 32min
	19 h 32 min
	7 h 32 min

	13 h 10 min
	14 h 20 min
	15 h 20 min

	12 h 30 min
	13 h 20 min
	1 h 20 min

	16 h 35 min
	15 h 40 min
	3 h 40 min

	18 h 45 min
	18 h 55 min
	7 h 55 min

Il est...	Dans combien de temps sera-t-il... ?	(min)
4h07	5 h ?	.....MIN
19h36	20 h ?	.....MIN
11h55	midi ?	.....MIN
16h25	17 h ?	....MIN
13h41	14 h ?	.....MIN