Name: _____

BASIC SHAPES BLOCKS

A Match the basic shape blocks correctly.

1. 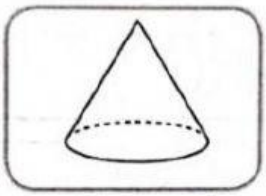

2. 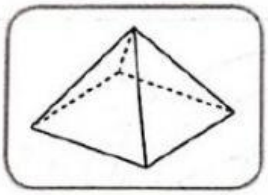

3. 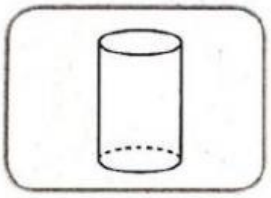

4. 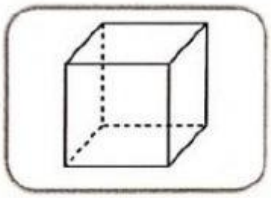

5. 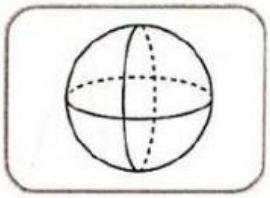

6. 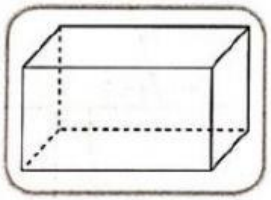

7. 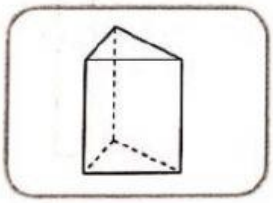

a. Cube

b. Cuboid

c. Pyramid

d. Prism

e. Cone

f. Cylinder

g. Sphere

B **Match the objects below to the importance of their shapes in daily life.**
Padankan objek-objek di bawah dengan kepentingan bentuknya dalam kehidupan harian. LS10.1.4

HOTS Analysing

1.

2.

3.

4.

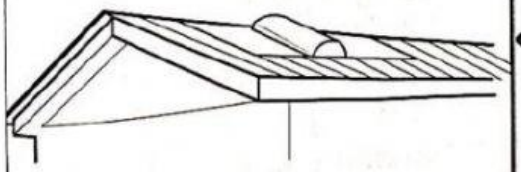

- Easy to roll
  Mudah untuk digolekkan
- To facilitate movement
  Untuk memudahkan pergerakan
- To facilitate the flow of rainwater
  Untuk memudahkan air hujan mengalir
- Easy to hold
  Mudah untuk dipegang