Name _____

Addition Number Line (to 5)

Use the number line to solve. Show your jumps.

1. 1+1= ☐

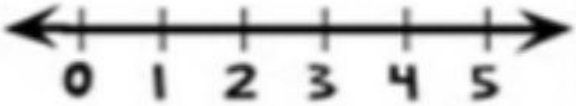

2. 2+2= ☐

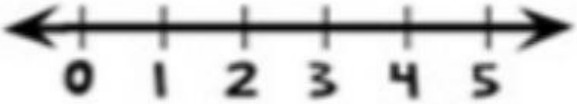

3. 4+1= ☐

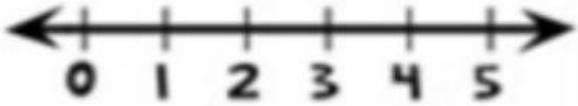

4. 2+3= ☐

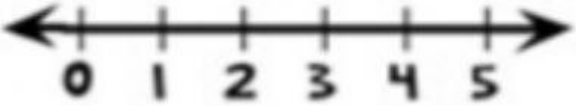

5. 3+2= ☐

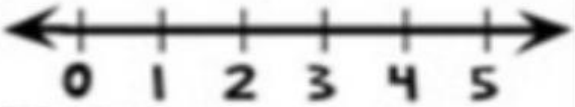
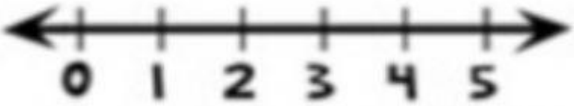
6. 1+3= ☐