Comparacion de figuras

Observa las figuras anota que cantidad de cuadros tiene cada una

1)



2)



3)



4)



5)


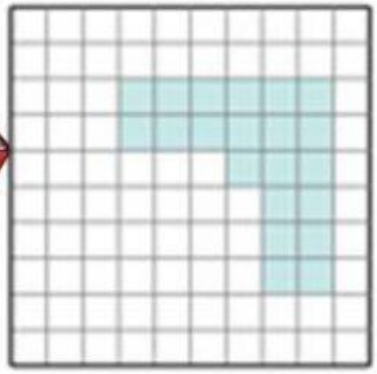
6)