WORKSHEET
HALVES AND QUARTERS

CLASS - IV
SUBJECT-MATHEMATICS

Pick the right fraction represented by the shaded part of each shape.First one is done as an example.

1) 	$\frac{1}{2}$	$\frac{3}{6}$	$\frac{5}{6}$	$\frac{1}{6}$	$\frac{6}{5}$
2) 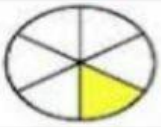	$\frac{1}{4}$	$\frac{3}{4}$	$\frac{1}{6}$	$\frac{1}{3}$	$\frac{1}{5}$
3) 	$\frac{1}{2}$	$\frac{3}{8}$	$\frac{1}{6}$	$\frac{1}{7}$	$\frac{6}{8}$
4)	$\frac{1}{3}$	$\frac{3}{6}$	$\frac{1}{2}$	$\frac{1}{5}$	$\frac{1}{4}$
5) 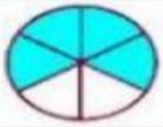	$\frac{4}{6}$	$\frac{5}{6}$	$\frac{4}{5}$	$\frac{1}{6}$	$\frac{3}{5}$
6)	$\frac{1}{3}$	$\frac{1}{4}$	$\frac{1}{2}$	$\frac{1}{5}$	$\frac{2}{1}$
7) 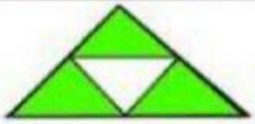	$\frac{1}{2}$	$\frac{3}{4}$	$\frac{5}{6}$	$\frac{1}{4}$	$\frac{4}{3}$
8) 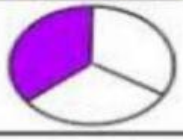	$\frac{1}{6}$	$\frac{2}{3}$	$\frac{3}{3}$	$\frac{1}{3}$	$\frac{2}{5}$
9)	$\frac{3}{5}$	$\frac{3}{4}$	$\frac{5}{4}$	$\frac{4}{6}$	$\frac{4}{5}$