Teliti gambar dan lengkapkan jadual yang diberi.




| Buah | Kuantiti | Harga | Ayat Matematik |
|---|---|---|---|
| | 3 | RM 7 | 3 × RM7 = RM21 |
| | 5 | | |
| | 6 | | |
| | 7 | | |
| | 9 | | |

Teliti gambar dan lengkapkan jadual yang diberi.



RM2299.90

RMI055

RM89.90

RM159.90

| Barang | Kuantiti | Harga | Pengiraan |
|---|---|---|---|
| | 5 | RMI055 | |
| | 7 | RM89.90 | |
|  | 3 | RM2299.90 | |
| | 10 | RM159.90 | |