1.a) Jadual 1 di bawah menunjukkan simbol bagi komponen elektronik.

Transistor	Induktor	Diod
Kapasistor	Perintang	Sel kering

Simbol	Nama komponen elektronik
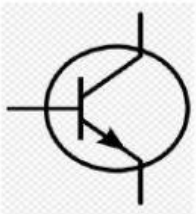	
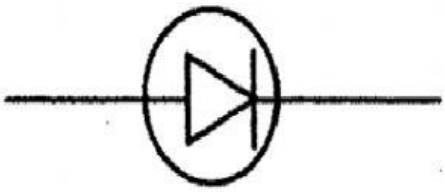	
	

4 markah

b) Rajah 2 menunjukkan rajah blok bagi sistem penerima radio.

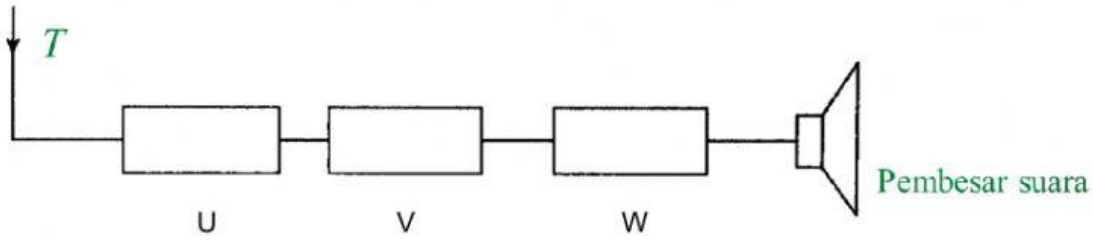

i) Nyatakan fungsi T?

.....

1 markah

ii) Nyatakan bahagian U, V dan W ?

U : .....

V : .....

W : .....

3 markah

iii) Nyatakan komponen elektronik yang terdapat pada V?

.....

1 markah

iv) Nyatakan perubahan tenaga yang berlaku di pembesar suara.

.....

1 markah