Maths Test Practice

A)-Write in number or in word form.

Example: **10,623**: ten thousand, six hundred and twenty-three One thousand, two hundred and ten: 1,210

1) 1,345:_____

2) 3,798:_____

3) 7,679:_____

4) Two thousand, one hundred and twenty-four:_____

5) Twenty-six thousand, four hundred and eleven: _____

B) Write the name of the following polygons.

quadrilatetal	**triangle**	**octagon**	**pentagon**	**hexagon**

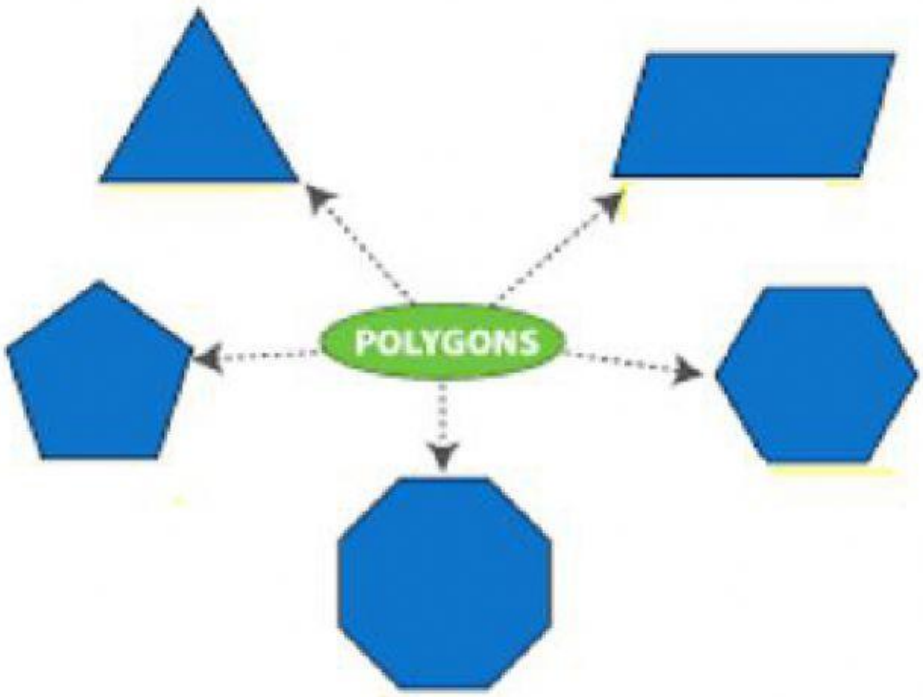

C) Find the perimeter of each shape.

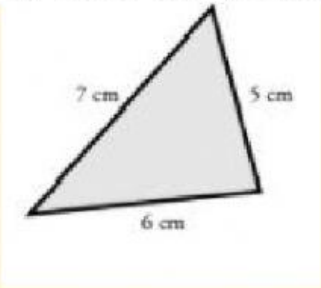

Perimeter:_____

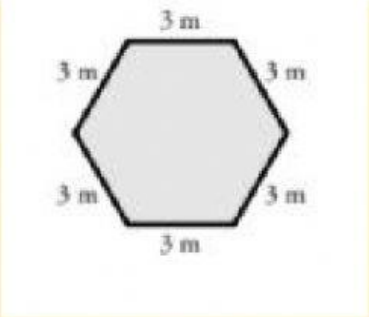

Perimeter:_____

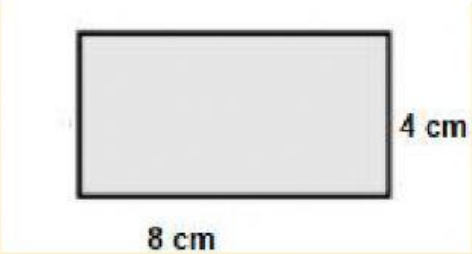

Perimeter:_____

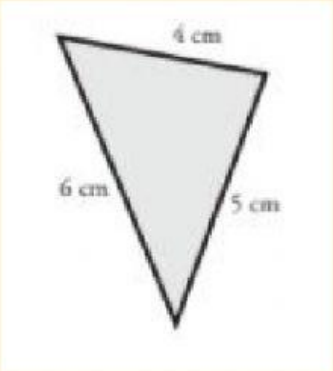

Perimeter:_____

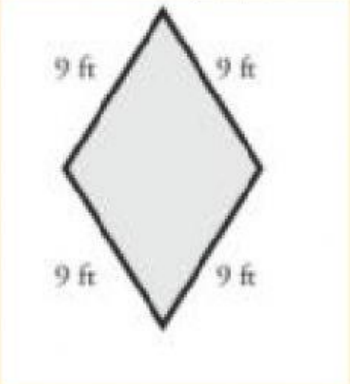

Perimeter:_____