Name :_____

Mathematics

Word Problems

Read each problem. Write the equation on the line then solve.

1. 4 birds in a tree.

   3 birds join them.

   How many in all?

   _____ + _____ = _____



2. 5 bees on a flower.

   3 bees fly by.

   How many in all?

   _____ + _____ = _____



3. 2 ducks in a pond.

   3 ducks on the sand.

   How many in all?
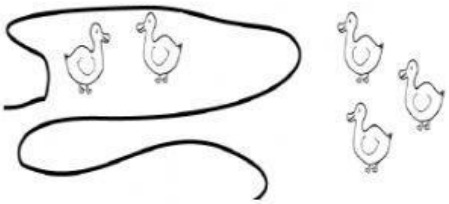
   _____ + _____ = _____