Name: _____ Date: _____



Mathematics

Multiplication

Create a multiplication sentence using the following arrays.





☐ x ☐ = ☐ ☐ x ☐ = ☐

Find the product.

5 x 10 = _____ 4 x 3 = _____ 4 x 6 = _____

3 x 11 = _____ 5 x 6 = _____ 7 x 3 = _____

4 x 12 = _____ 2 x 8 = _____ 8 x 0 = _____

32	41	33	24
x 2	x 2	x 3	x 2
_____	_____	_____	_____