Geometry
Parallel, perpendicular, and inspecting lines

What are these lines? Fill in the blanks with "parallel", "perpendicular" or "intersecting".

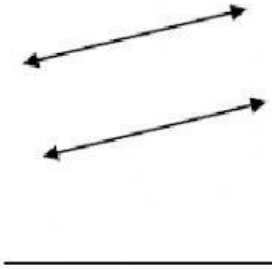 _____	 _____	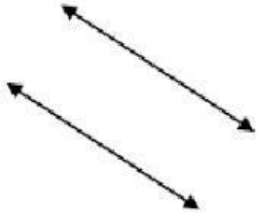 _____
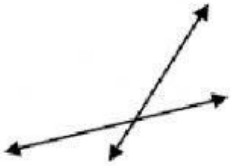 _____	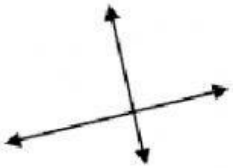 _____	 _____
 _____	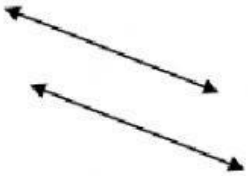 _____	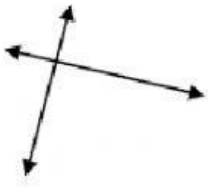 _____
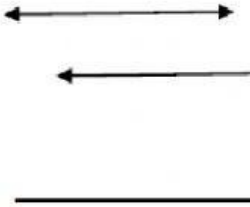 _____	 _____	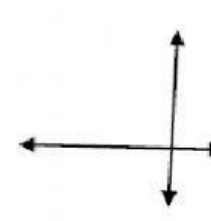 _____
_____	_____	_____