Mathematics-Measurement

Select the correct option, according to each question.

Which is **shorter**? 	Which is **longer**? 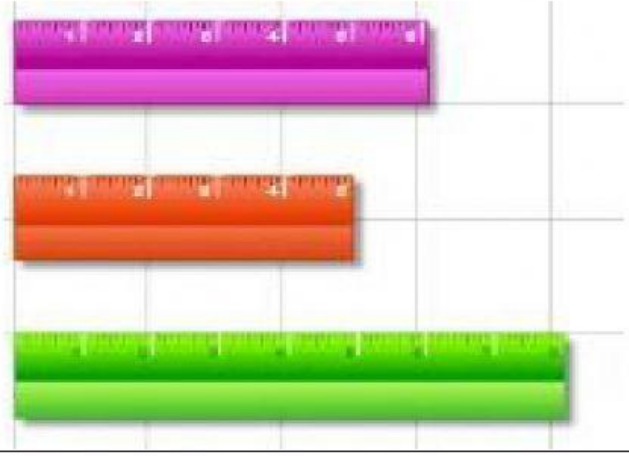
Which is the **biggest?** 	Which is the **shortest**? 
Which is **smaller?** 	Which is **bigger**? 