MATHEMATICS
DESCENDING ORDER

Name: _____ Grade: 2

Instructions: Write the numbers in descending order.

1.

_____

2. 

_____

3. 

_____

4. 

_____

5. Look at the sets of numbers. Choose the numbers that are in descending order.

   a. 309, 284, 230, 319

   b. 319, 309, 284, 230

   c. 230, 284, 309, 319

   d. 309, 319, 280, 230