¿Cuántos tripulantes hay?

5 + 5 = ...

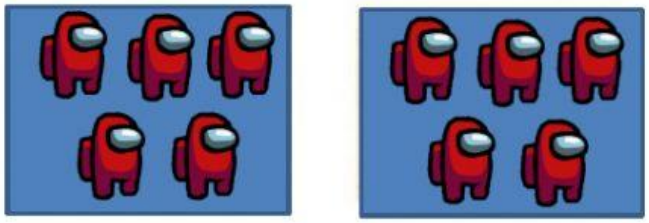

2 grupos de 5 = 10

2 veces 5 = 10

5 + 5 =10

2 x 5

4 + 4 = ...

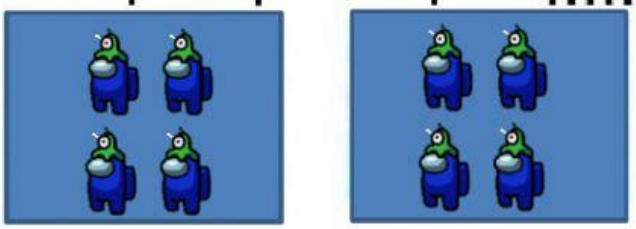

2 grupos de 4 = 8

2 veces 4 = 8

4 + 4 = 8

2 x 4 = 8

3 + ☐ + ☐ + ☐ = ☐

☐ x ☐ = ☐

☐ + ☐ + ☐ + ☐ + ☐ + ☐ = ☐

☐ x ☐ = ☐

☐ + ☐ + ☐ + ☐ + ☐ + ☐ + ☐ = ☐

☐ x ☐ = ☐



3 X 2 =.....

2 X 4 =.....

5 X ☐ =.....

5 X ☐ =.....

☐ X ☐ =.....

☐ X ☐ =.....

☐ X ☐ =.....

☐ X ☐ =.....