MATEMATIK TAHUN 1

NAMA: _____ KELAS: _____

Labelkan "jarum jam" dan "jarum minit"

Jarum minit

Jarum jam

Padankan.

Setengah jam

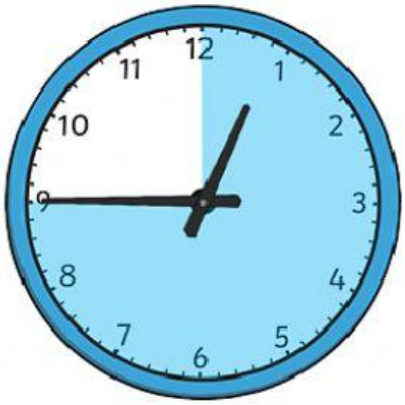

Suku jam

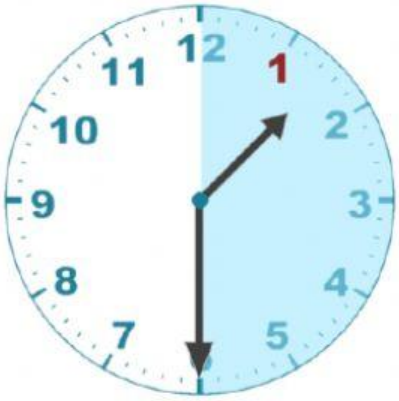

Tiga suku jam

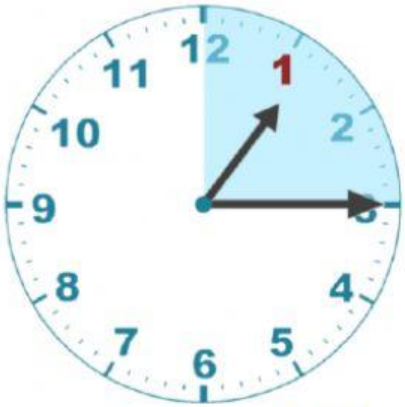

Koleksi Latihan
Cikgu CTZubaidah