Fracciones

Escribe las fracciones que representa cada gráfica.

a) $\frac{\quad}{\quad}$

b) $\frac{\quad}{\quad}$



c) $\frac{\quad}{\quad}$

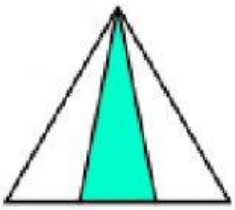

d) $\frac{\quad}{\quad}$

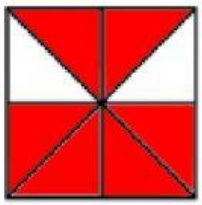

e) $\frac{\quad}{\quad}$

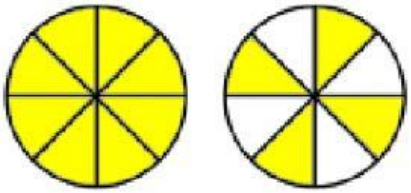

f) $\frac{\quad}{\quad}$

Ejercicios Resueltos.net

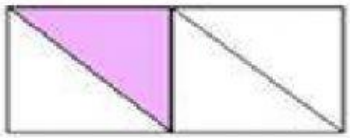

____

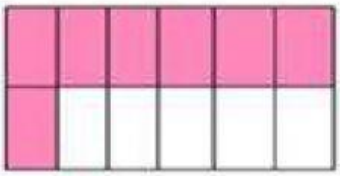

____

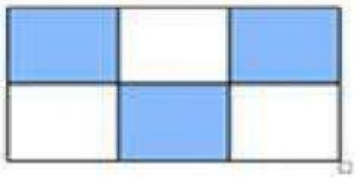

____

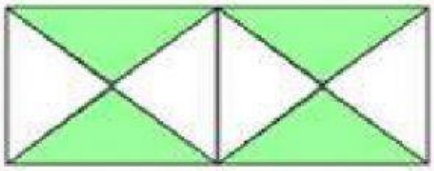

____
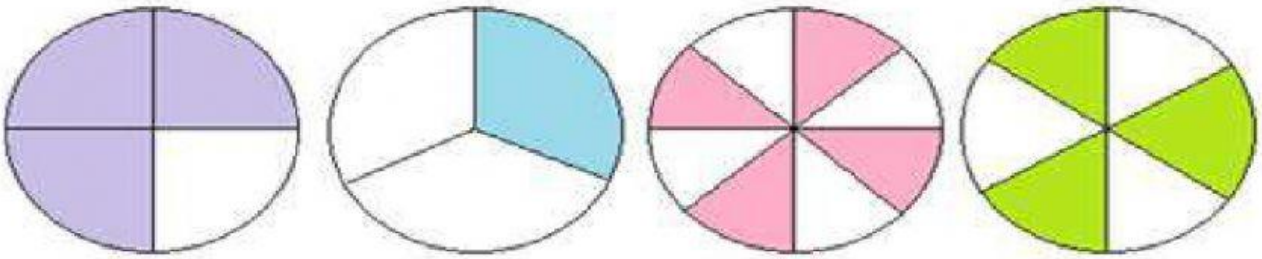
____ ____ ____ ____