UNIDAD EDUCATIVA BILINGÜE INTERNATIONAL SCHOOL
AÑO LECTIVO 2020-2021

MULTIPLICACIÓN LINEAL Y ARREGLOS RECTANGULARES

1. OBSERVA LAS SEMIRRECTAS NUMÉRICA Y UNE CON LA MULTIPLICACIÓN QUE LE CORRESPONDE.

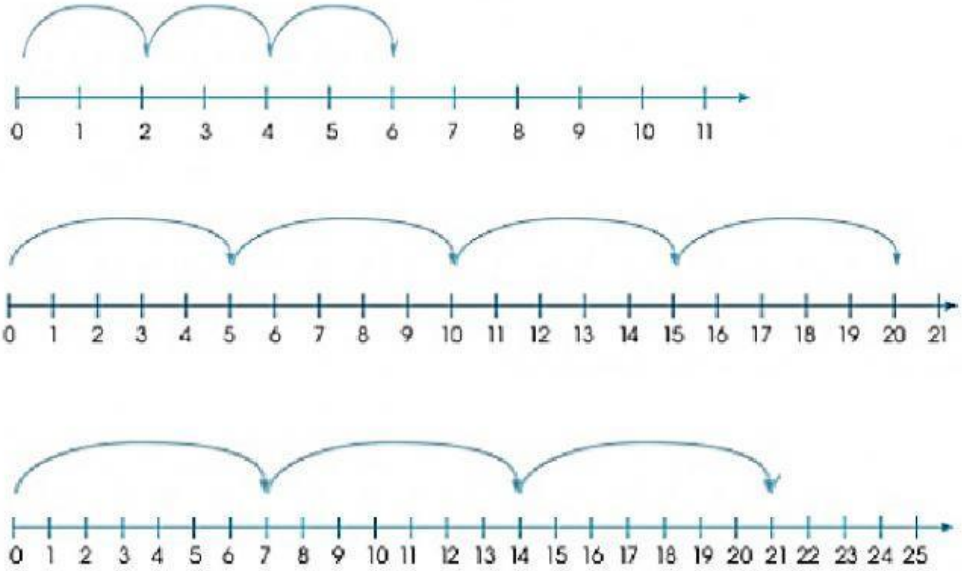

3 X 7

3 X 2

4 X 5

2.ESCOJE LA MULTIPLICACIÓN REPRESENTADA CON LOS ARREGLOS RECTANGULARES.