حدد ما إذا كل جدول يمثل دالة خطية أم غير خطية .

1

x	1	2	3	4
y	5	10	15	20

2.

x	1	2	3	4
y	1	4	9	16

3

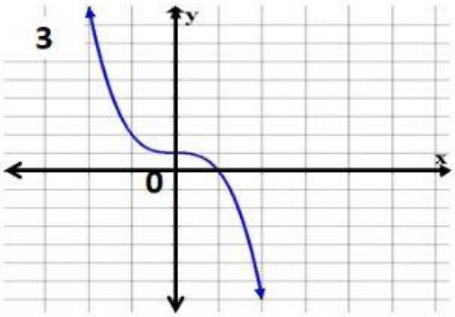

4

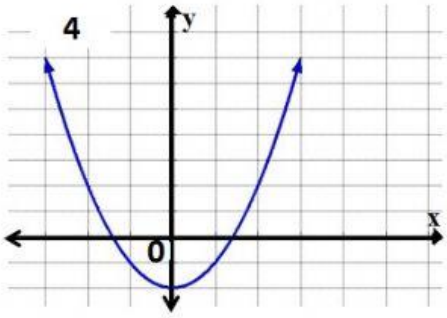
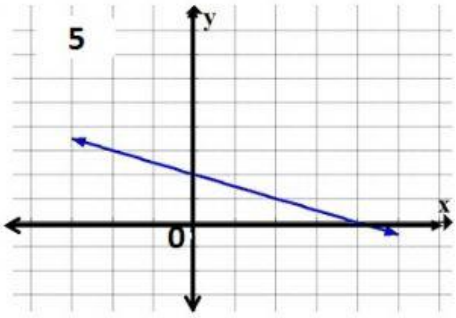
5