طابق كل معادلة بالتمثيل البياني الخاص بها.

A

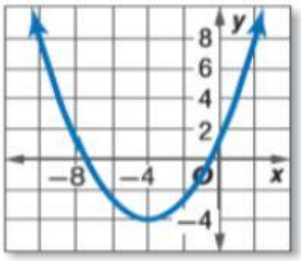

B

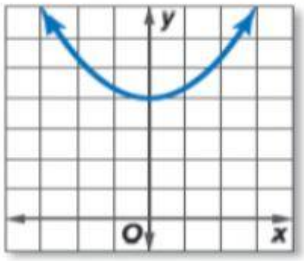

C

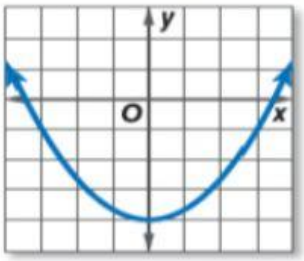

D

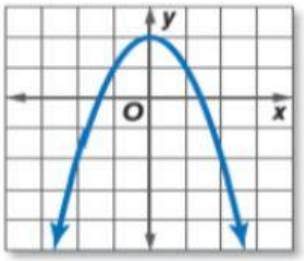

E

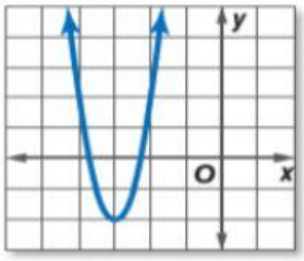

F

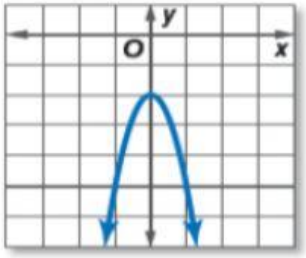

$y = \frac{1}{3}x^2 - 4$

$y = -3x^2 - 2$

$y = \frac{1}{3}(x + 4)^2 - 4$

$y = -x^2 + 2$

$y = \frac{1}{3}x^2 + 4$

$y = (2x + 6)^2 - 2$