LEMBAR KERJA PESERTA DIDIK
(LKPD)

Nama : _____
Kelas : **2C**

Ayo Berlatih

Hitunglah banyak rusuk, sisi, dan titik sudut bangun-bangun ruang berikut!

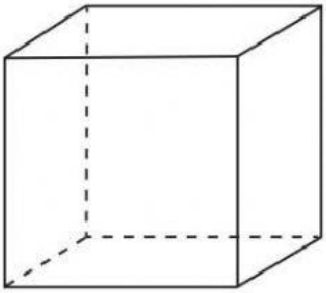

Banyak Rusuk : ...
Banyak Sisi : ...
Banyak Titik Sudut : ...

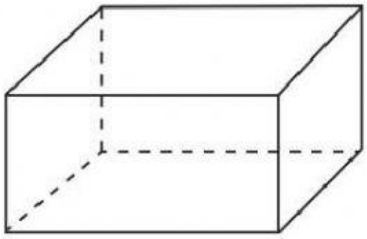

Banyak Rusuk : ...
Banyak Sisi : ...
Banyak Titik Sudut : ...

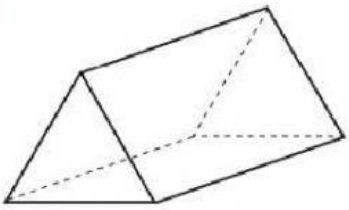

Banyak Rusuk : ...
Banyak Sisi : ...
Banyak Titik Sudut : ...

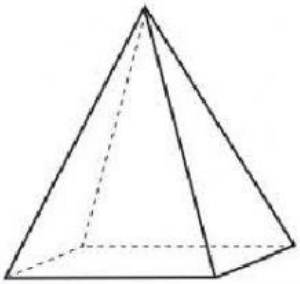

Banyak Rusuk : ...
Banyak Sisi : ...
Banyak Titik Sudut : ...