Olimpiadas de Matemáticas 2

COLEGIO PRINCIPADO DE MÓNACO
"A new concept of education"

Lic. Yasmin Tello Romero
Grado: segundo

Olimpiadas Matemáticas

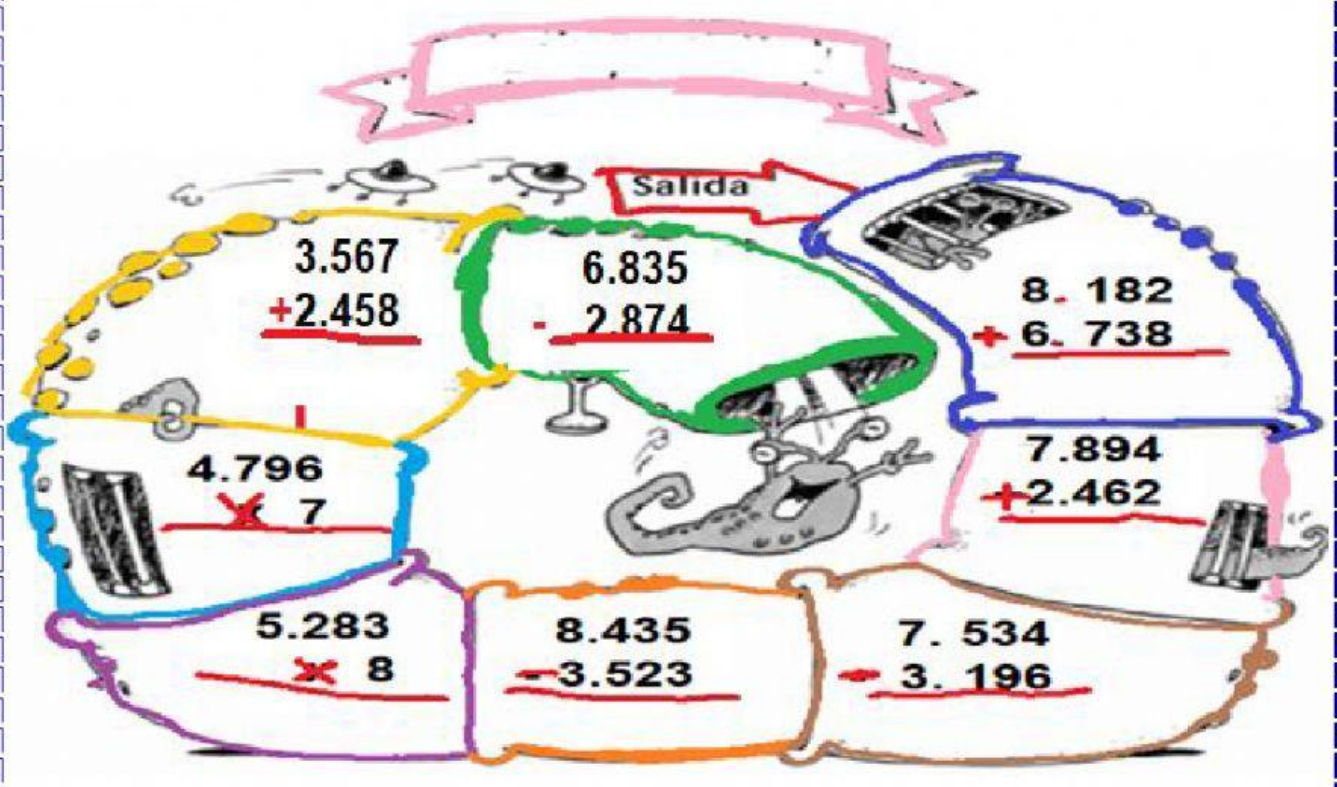

Arrastra cada pieza al resultado que le corresponde

20	**54**	36	30	16
9	12	**18**	24	**63**
48	32	45	**72**	21
49	**42**	27	15	28

Realiza las multiplicaciones y escribe el resultado con letra donde le corresponde.

1. 6X5= ☐
2. 2X4= ☐
3. 9X9= ☐
4. 7X8= ☐
5. 4X5= ☐
6. 5X3= ☐
7. 8X9= ☐
8. 3X8= ☐
9. 9X6= ☐
10. 7X6= ☐

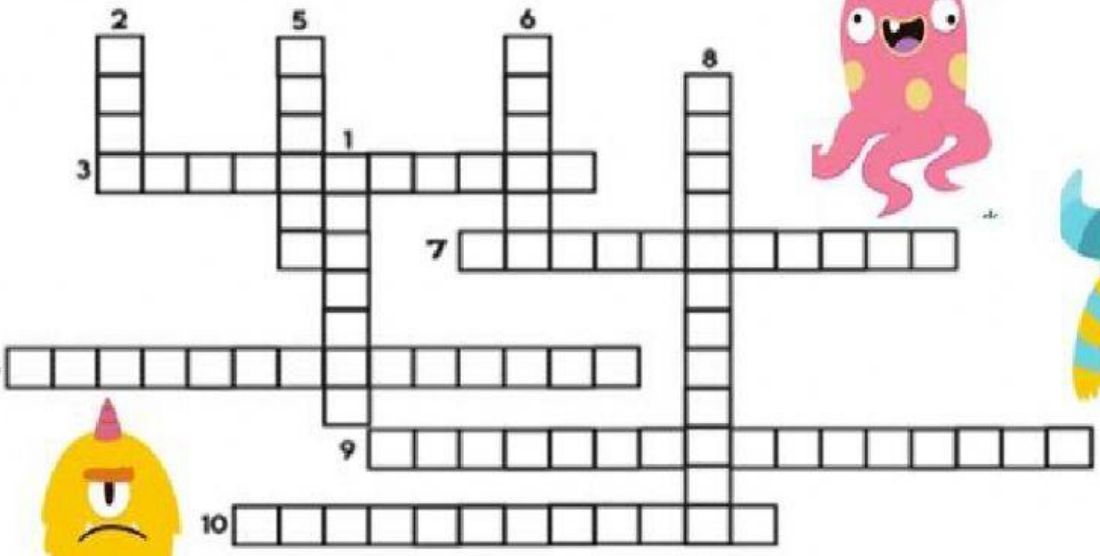

- 8 ÷ 2 = ☐ porque ☐ × ☐ = 8
- 10 ÷ 2 = ☐ porque ☐ × ☐ = ☐
- 15 ÷ 3 = ☐ porque ☐ × ☐ = ☐
- 27 ÷ 3 = ☐ porque ☐ × ☐ = ☐
- 9 ÷ 3 = ☐ porque ☐ × ☐ = ☐
- 18 ÷ 2 = ☐ porque ☐ × ☐ = ☐

Escribe el nombre de los siguientes números

7	5.	6	9	4
1	4.	5	8	3
3	1.	1	3	2
4	3.	0	2	7
2	2.	5	9	1
8	8.	4	0	6
5	9.	3	8	4
9	0.	6	2	1
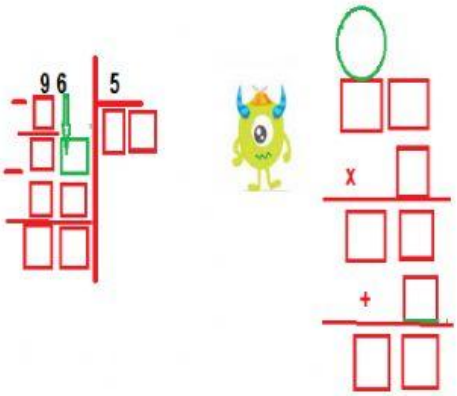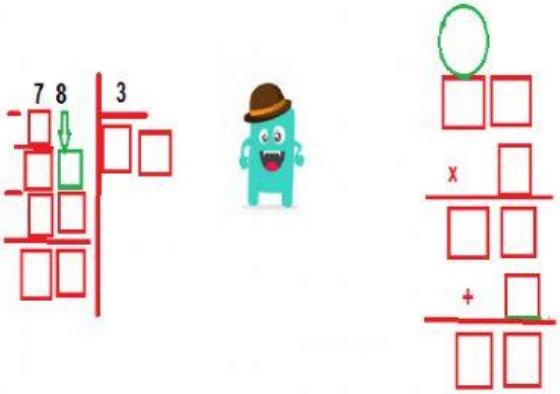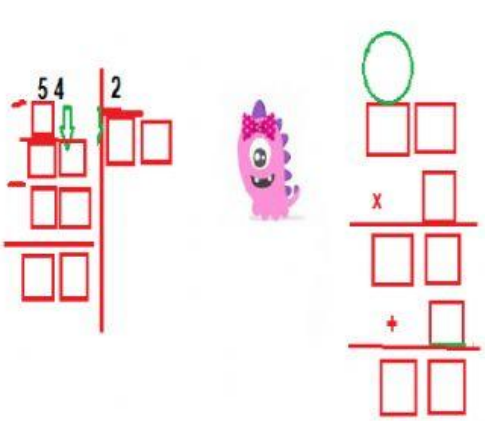
Resuelve las divisiones y haz la prueba de las divisiones: