点击选择正确的答案。

5

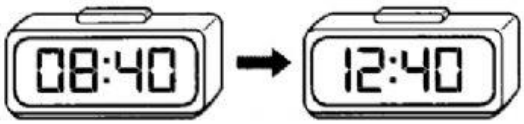

时间过了_____分钟或

_____小时。

6

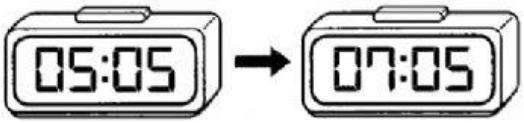

时间过了_____分钟或

_____小时。

7

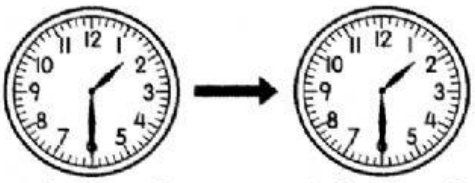

星期五下午　　星期一下午

时间过了_____小时或

_____天。

8

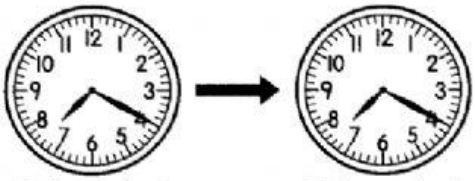

星期三上午　　星期五上午

时间过了_____小时或

_____天。