ESCUELA DE EDUCACIÓN BÁSICA
"EDUARDO KINGMAN"

eduardokingman13@hotmail.com
Sibambe # 510 y Ambato

LECCIÓN DE MATEMÁTICAS

Nombre:_____ **2do Año Básico**

1 Observa cuenta y completa con la respuesta correcta

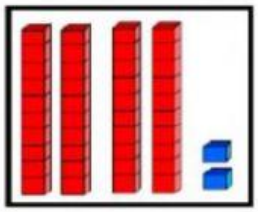  _____Decenas _____ unidades	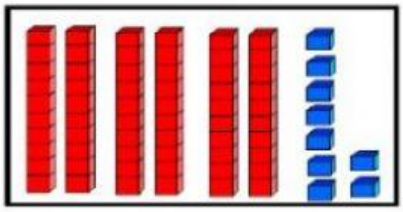 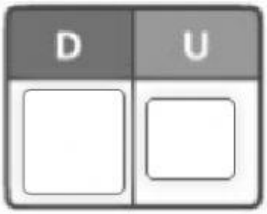 _____Decenas _____ unidades

2.- Selecciona y completa la tabla

	25	20+5	2D+5U

3.- En la siguiente tabla selecciones las decenas

10	7	30	9	20
0	90	4	50	
6	60	100	40	8

4.- Une con línea la base 10 con el numero que corresponde

10

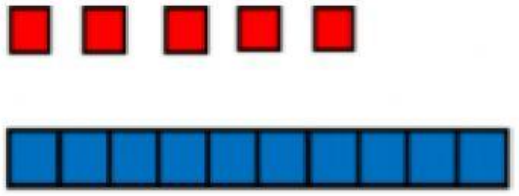

13

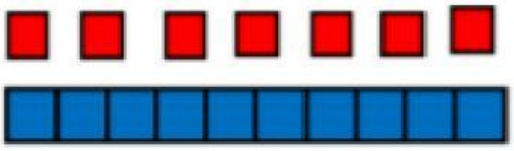

15

17

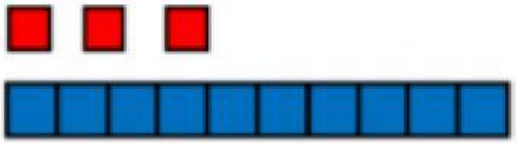

5- Dictado de números