Esan zein zenbaki dagoen adierazita kasu bakoitzean.
Lehendabizi, ehunekoak, hamarrekoak eta unitateak zenbatu.

1)

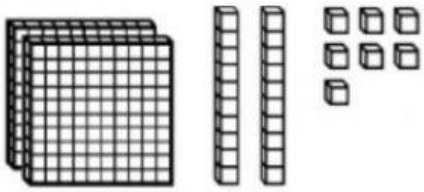

E H U

Zenbakia

2)

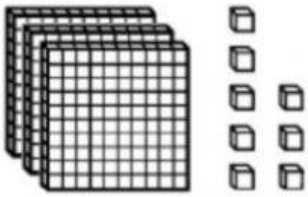

E H U

Zenbakia

3)

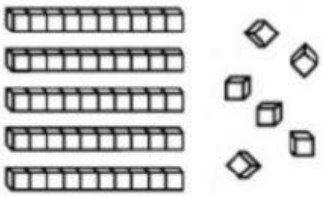

E H U

Zenbakia

4)

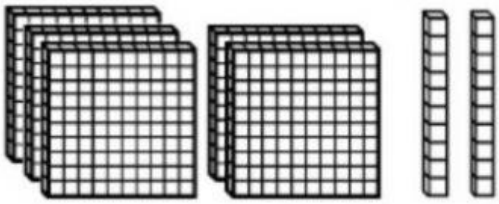

E H U

Zenbakia

5)

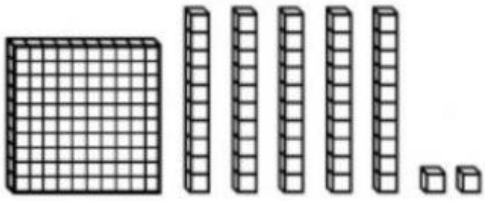

E H U

Zenbakia