Name: _____ **Date:** _____

Find the length of the side marked x.

1.

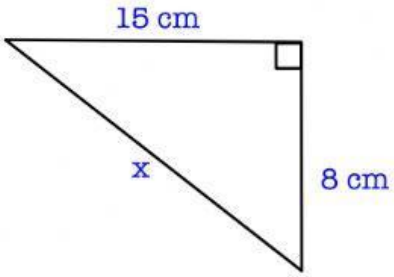

Answer: x = _____ **cm.**

2.

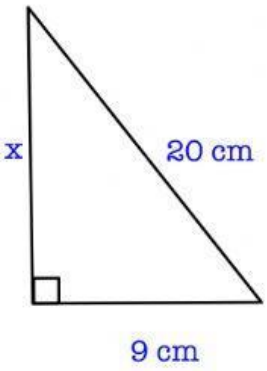

Answer: x = _____ **cm.**

3.

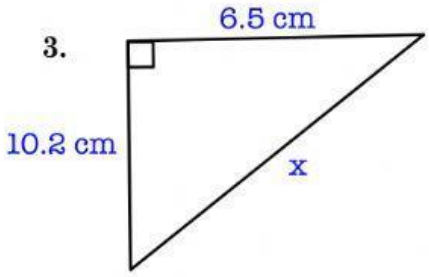

Answer: x = _____ **cm.**

4.

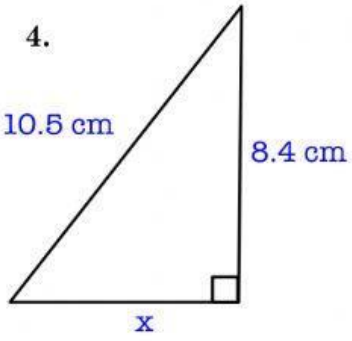

Answer: x = _____ **cm.**

5.

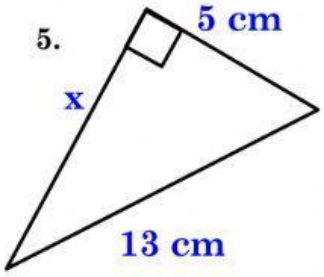

Answer: x = _____ **cm.**