Fracciones

Unir con flechas

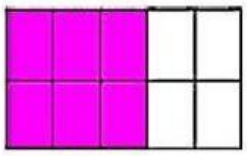

$\frac{6}{10}$

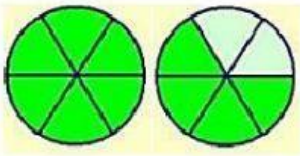

$1\frac{4}{6}$

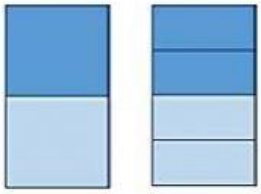

$\frac{1}{2} = \frac{2}{4}$



$\frac{8}{4}$

FRACCIÓN IMPROPIA

FRACCIÓN EQUIVALENTE

FRACCIÓN PROPIA

FRACCIÓN MIXTA

Arrastrar y colocar las fracciones en la columna que corresponde

FRACCIONES PROPIAS			FRACCIONES IMPROPIAS	
		$\frac{6}{5}$ $\frac{2}{3}$ $\frac{4}{3}$ $\frac{2}{5}$		
		$\frac{8}{6}$ $\frac{4}{8}$ $\frac{1}{2}$ $\frac{9}{3}$		

Selecciona los cuadritos para representar las fracciones mixtas.

$1\frac{1}{6}$ ➡

$2\frac{1}{2}$ ➡

$2\frac{4}{4}$ ➡

$2\frac{1}{5}$ ➡
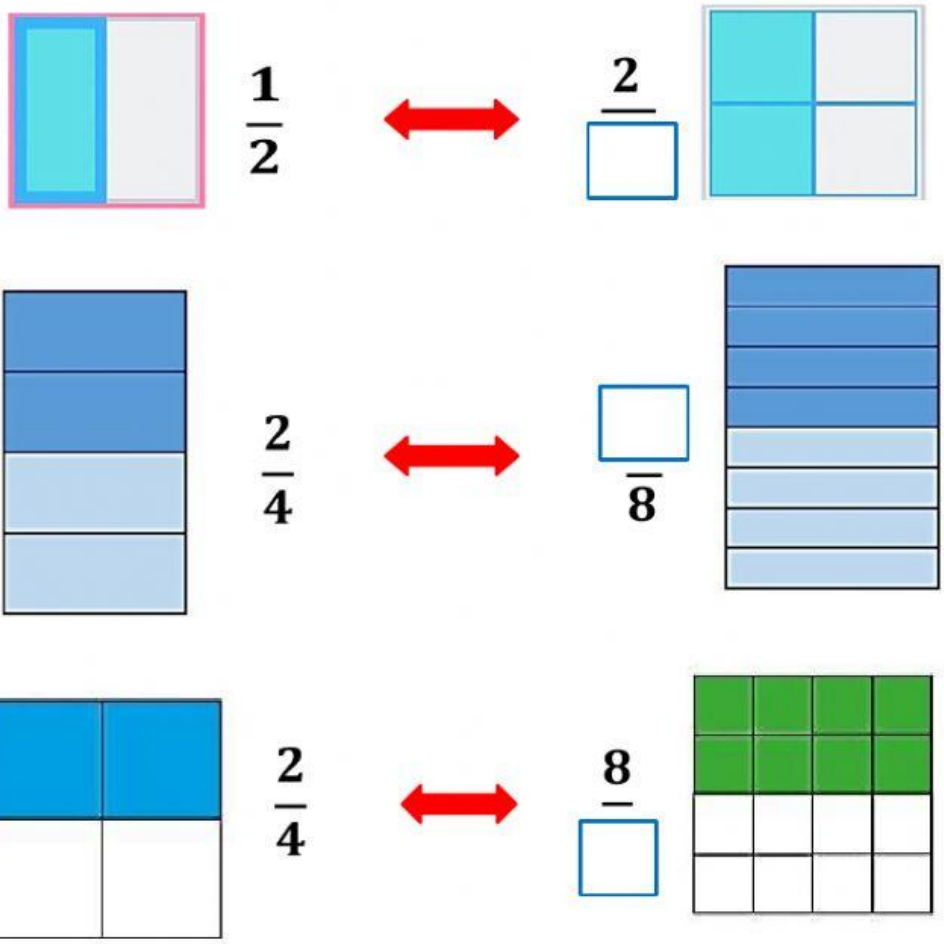
Completar con el número que falta para que resulten equivalentes