GIMNASIO BILINGÜE CAMPESTRE MARIE CURIE
Resolución de aprobación No. 647 del 28 de Noviembre de 2018 (SEC)
"Everything humankind has created originates within the mind so, develop your mind and it will make an invaluable contribution"

SCIENCE
FOURTH TERM
FIRST _____

NAME: _____ **DATE:** _____

1. Write Solid, Gas, or Liquid.



2. What kind of force are they using?

push pull

pull push

3. Look at the picture and select the correct option for each kind of motion.

a. Round and round
b. In a straight-line
c. In a zig-zag

a. Round and round
b. In a straight-line
c. In a zig-zag



a. Round and round.
b. In a straight line
c. In a zig-zag

4. Select the correct option according to how they are sort.



COLOR

SIZE

SHAPE

5. Match the words according to the picture

Dissolved

Mixture

Separated

Images from https://www.teacherspayteachers.com/Product