Class-1 Subject: Maths

Chapter- 1

Shapes and Space

Worksheet

Tick(✓) the pot on the top.



Tick(✓) the animal at the bottom of the stairs.

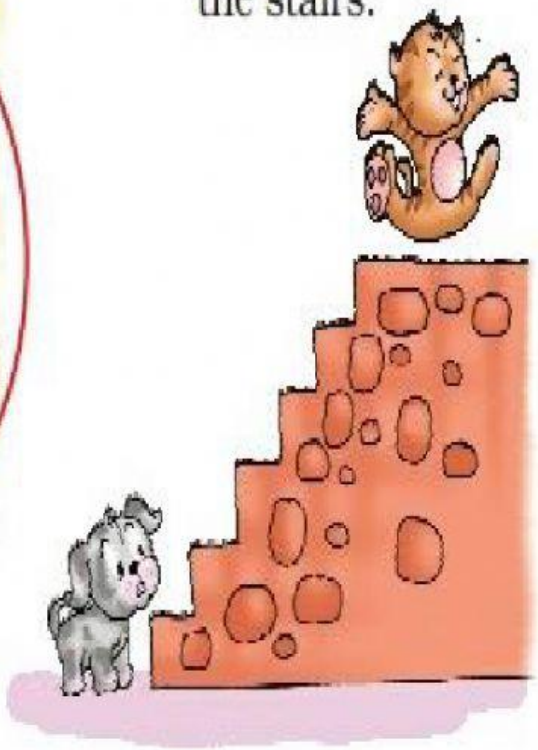

## Nearer-Farther

Tick(✓) the bird nearer to home.

Tick(✓) the cat farther from the tree.

Tick(✓) the puppy farthest from the tree.

Tick(✓) the tree nearest to the bird.