Realitza les operacions

1.- Suma

1

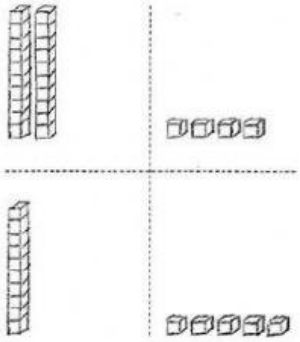

$$\begin{array}{r} 24 \\ +\ 15 \\ \hline \square \end{array}$$

2

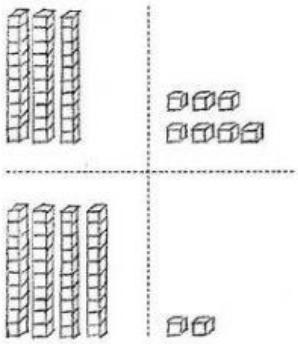

$$\begin{array}{r} 37 \\ +\ 42 \\ \hline \square \end{array}$$

2.- Escriu i suma

1

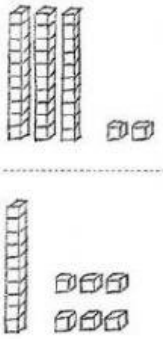

$$\begin{array}{r} 32 \\ +\ \square \\ \hline \square \end{array}$$

2

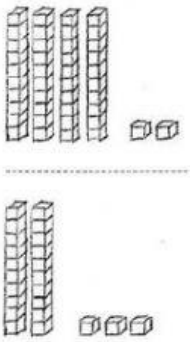

$$\begin{array}{r} 42 \\ +\ \square \\ \hline \square \end{array}$$

3

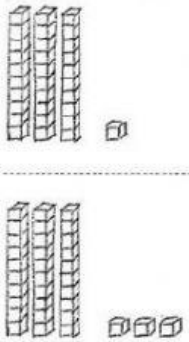

$$\begin{array}{r} \square \\ +\ \square \\ \hline \square \end{array}$$

4

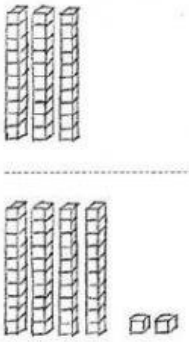

$$\begin{array}{r} \square \\ +\ \square \\ \hline \square \end{array}$$

5

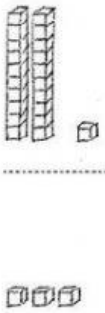

$$\begin{array}{r} \square \\ +\ \square \\ \hline \square \end{array}$$

6

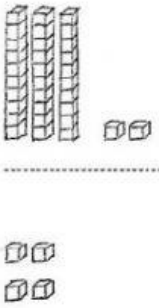

$$\begin{array}{r} \square \\ +\ \square \\ \hline \square \end{array}$$

3.- Suma

1. 32 + 6 = 38
2. 42 + 7 = ☐
3. 44 + 5 = ☐
4. 64 + 4 = ☐
5. 57 + 0 = ☐
6. 21 + 5 = ☐
7. 63 + 4 = ☐
8. 73 + 3 = ☐

4.- Coloca i suma

1. 11 + 23

```
  11
+ 23
----
  34
```

2. 12 + 34
3. 40 + 13
4. 53 + 26
5. 54 + 32
6. 23 + 70

CALCUL MENTAL

5 + 10	66 + 10	74 + 10
15 + 10	14 + 10	40 + 10
27 + 10	32 + 10	83 + 10

5.- Escriu el nombre que falta

1	2	3	4	5
5 + ☐ = 9	7 + ☐ = 10	☐ + 8 = 14	6 + ☐ = 12	☐ + 9 = 16

6.- Suma 10 cada vegada

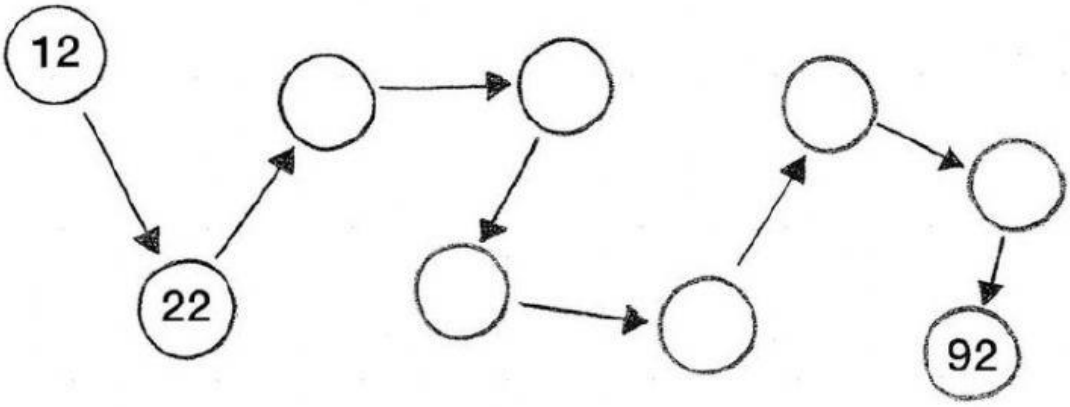

7.- Suma i compara

1 2 + 6 = ☐ 20 + 60 = ☐	2 3 + 5 = ☐ 30 + 50 = ☐	3 6 + 3 = ☐ 60 + 30 = ☐
4 4 + 5 = ☐ 40 + 50 = ☐	5 5 + 2 = ☐ 50 + 20 = ☐	6 2 + 7 = ☐ 20 + 70 = ☐
7 3 + 2 + 4 = ☐ 30 + 20 + 40 = ☐	8 2 + 6 + 1 = ☐ 20 + 60 + 10 = ☐	

8.- Suma

+	5	13	52
6	11		
30			
24			

+	4	15	33
3			
21			
54			

9.- Compta de 2 en 2

80 —+ 2→ 82 —+ 2→ ( ) —+ 2→ ( ) —+ 2→ ( ) —+ 2→ 90

10.- Compta de 3 en 3

60 —+ 3→ 63 —+ 3→ ( ) —+ 3→ ( ) —+ 3→ ( ) —+ 3→ 75

11.- Completa

1. 32 + 14 = 46
2. [ ] + 2 = 58
3. 30 + [ ] = 67
4. [ ] + 21 = 39
5. 50 + [ ] = 90
6. [ ] + 72 = 85
7. 24 + [ ] = 29
8. [ ] + 30 = 43

12.- Realitza les sumes per resoldre l'enigma

El conill que aconsegueixi 79 punts es menjarà la pastanaga, quin serà?



Pipo



Pepo

20	+ 5	+ 2	+ 3	+ 12	+ 4	+ 3	+ 1	+ 15	+ 2	+ 7
+ 4	+ 10	+ 5	+ 1	+ 4	+ 15	+ 1	+ 5	+ 4	+ 1	20

Punts d'en Pipo:

Punts d'en Pepo:

La pastanaga és per: