Observa i realitza les operacions

D	U
1	3
+	6
	9

Primer suma les unitats

Després suma les desenes

D	U
1	3
+	6
1	9

1.- Suma

1	2	3	4	5
15	11	13	13	12
+ 4	+ 6	+ 5	+ 4	+ 6
19				
6	7	8	9	10
5	7	3	4	1
+ 12	+ 11	+ 14	+ 10	+ 18
17				

2.- Suma

1	2	3	4	5
8	9	4	12	8
+ 2	+ 5	+ 13	+ 6	+ 5
10				

CALCUL MENTAL

Comnta

De 2 en 2 fins a 18 : 2, 4, 6,

De 2 en 2 des de l'1 fins a 17 : 1, 3, 5,

Observa i realitza les operacions



$$\begin{array}{r} 2 \\ 3 \\ +\ 4 \\ \hline 9 \end{array} \qquad \boxed{5}$$

2 + 3 + 4 = 9

3.- Suma

1. $\begin{array}{r} 1 \\ 2 \\ +\ 4 \\ \hline \boxed{7} \end{array}$
2. $\begin{array}{r} 5 \\ 3 \\ +\ 1 \\ \hline \boxed{} \end{array}$
3. $\begin{array}{r} 6 \\ 2 \\ +\ 1 \\ \hline \boxed{} \end{array}$
4. $\begin{array}{r} 4 \\ 2 \\ +\ 2 \\ \hline \boxed{} \end{array}$
5. $\begin{array}{r} 4 \\ 5 \\ +\ 1 \\ \hline \boxed{} \end{array}$
6. $\begin{array}{r} 6 \\ 1 \\ +\ 2 \\ \hline \boxed{} \end{array}$
7. $\begin{array}{r} 4 \\ 1 \\ +\ 5 \\ \hline \boxed{} \end{array}$
8. $\begin{array}{r} 6 \\ 6 \\ +\ 1 \\ \hline \boxed{} \end{array}$
9. $\begin{array}{r} 3 \\ 5 \\ +\ 1 \\ \hline \boxed{} \end{array}$
10. $\begin{array}{r} 3 \\ 3 \\ +\ 2 \\ \hline \boxed{} \end{array}$

4.- Suma

1. 3 + 5 + 4 = 12
2. 9 + 1 + 7 = ____
3. 4 + 2 + 7 = ____
4. 7 + 4 + 5 = ____
5. 3 + 6 + 1 = ____
6. 5 + 5 + 5 = ____
7. 5 + 6 + 7 = ____
8. 8 + 9 + 2 = ____

5.- Completa i suma

28. Dibuja, colorea y completa.

1

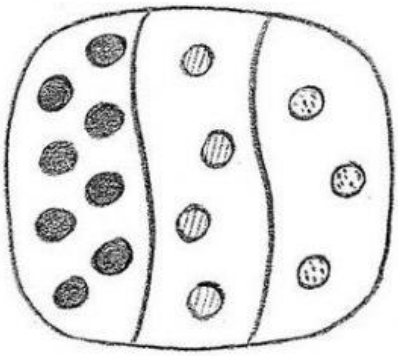

8 + 4 + 3 = 15

2

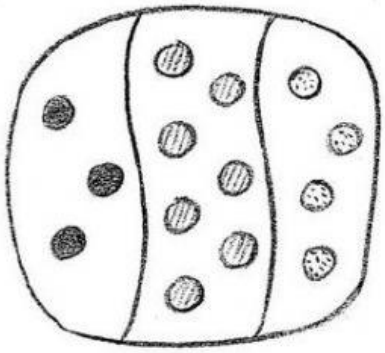

3 + ___ **+** ___ **=** ___

3

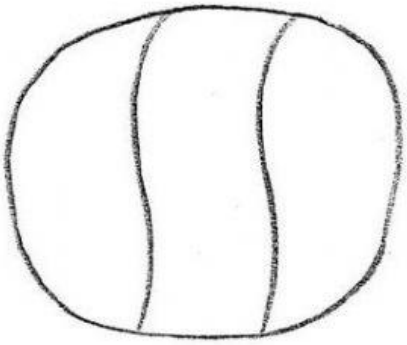

6 + 3 + ___ **= 16**

4

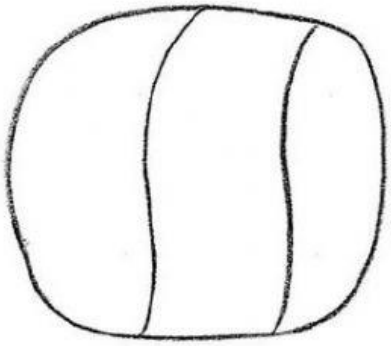

7 + 6 + ___ **= 18**

6.- Coloca i suma

1

13 + 5

	13
+	5
	18

2

12 + 6

3

11 + 4

4

3 + 11

5

4 + 10

6

2 + 14

Observa i realitza les operacions

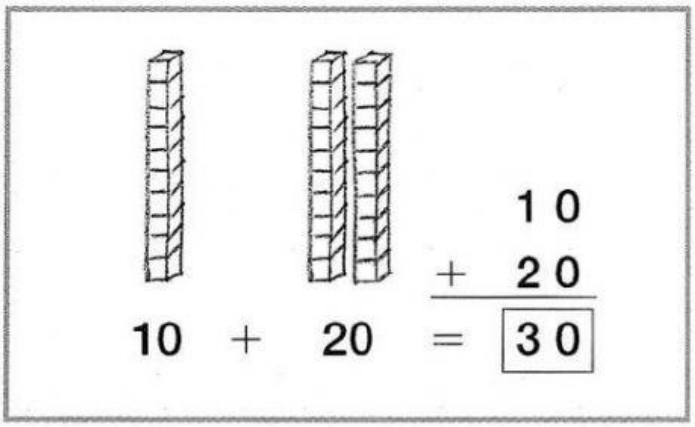

7.- Compta, escriu i suma

1

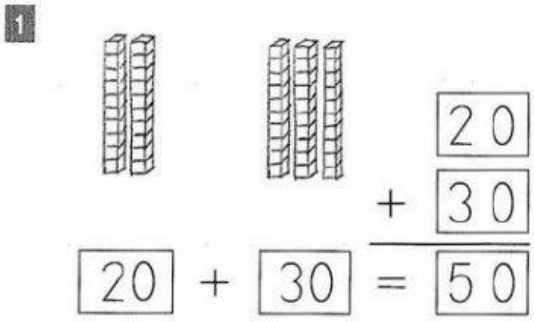

2

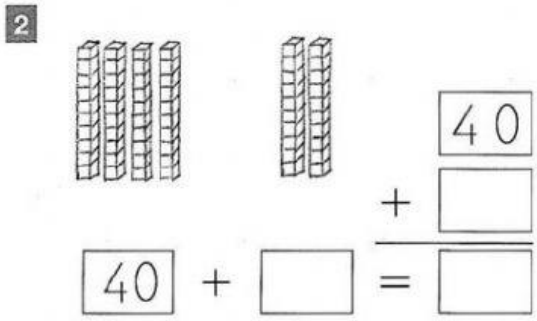

3

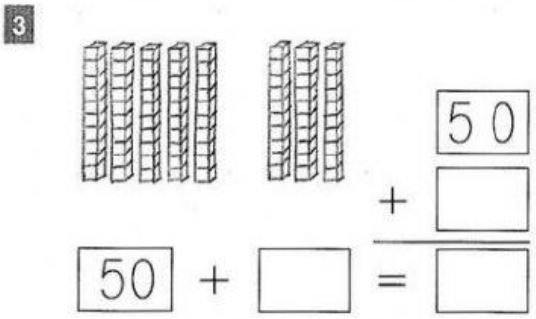

4

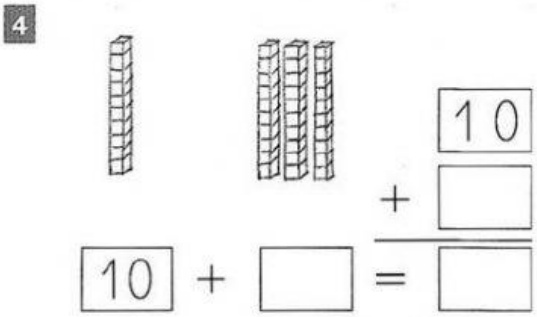

5

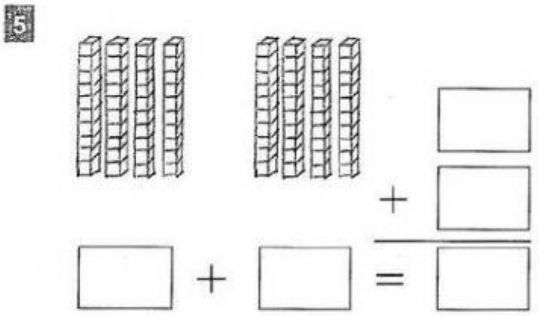

6

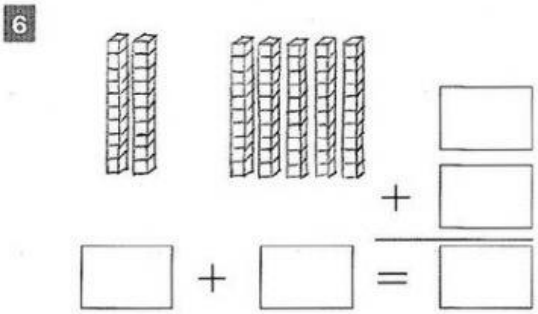

Observa i realitza les operacions

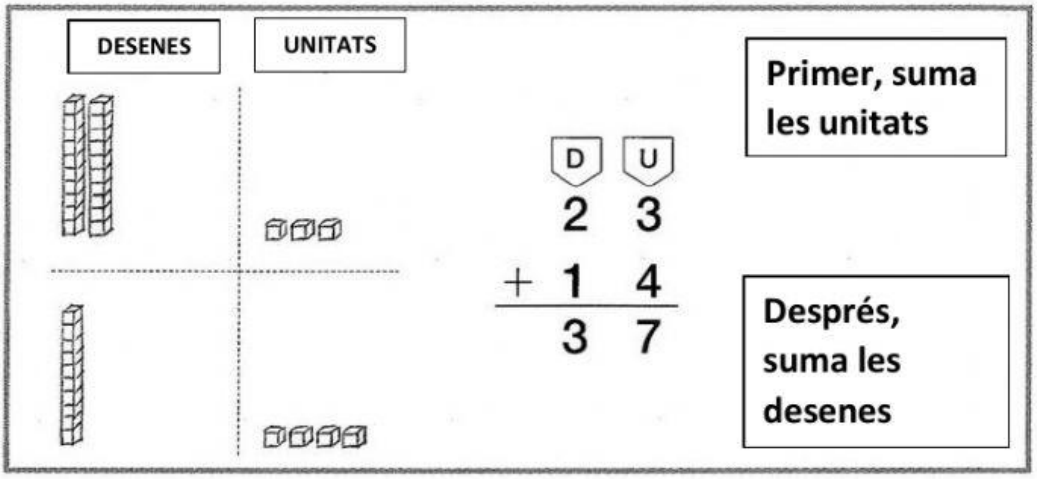

8.- Suma

1

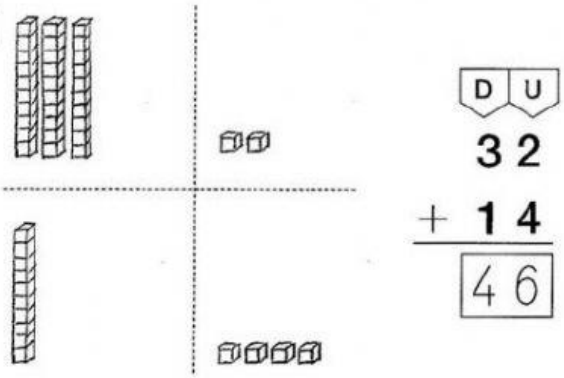

D U
3 2
+ 1 4
4 6

2

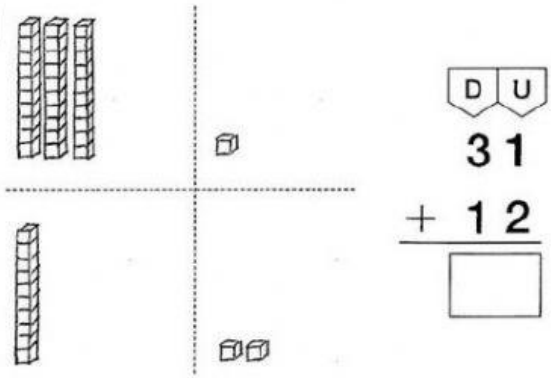

D U
3 1
+ 1 2
_____

3

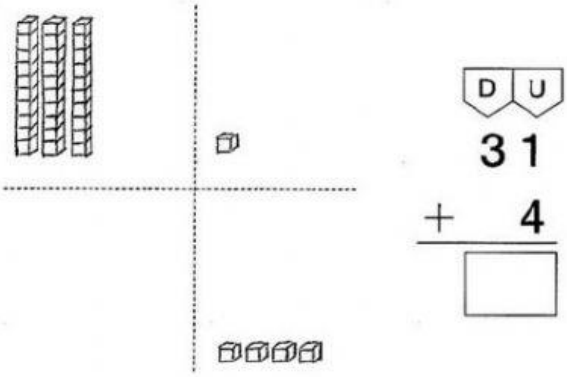

D U
3 1
+ 4
_____

4

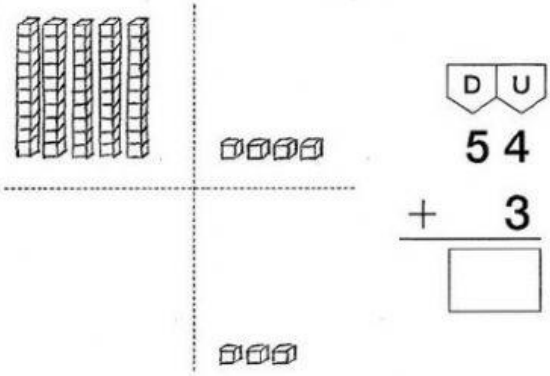

D U
5 4
+ 3
_____

9.- Suma

1 2 0
+ 3
2 3

2 3 1
+ 4
_____

3 2 7
+ 2
_____

4 4 0
+ 6
_____

5 2 5
+ 2
_____