Area of a Rectangle

T1L1S1

Find the area of each rectangle.

1)

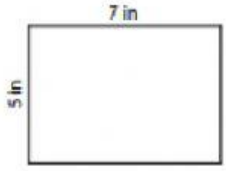

Area = ( )

2)



Area = ( )

3)



Area = ( )

4)

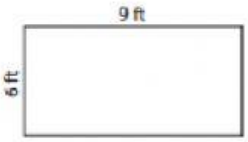

Area = ( )

5)



Area = ( )

6)



Area = ( )

7)

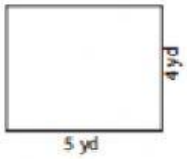

Area = ( )

8)

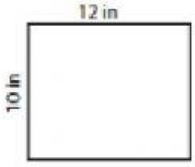

Area = ( )

9)

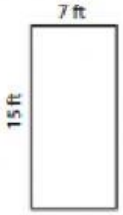

Area = ( )

LIVEWORKSHEETS

Area of a Rectangle

T1L1S2

Find the area of each rectangle.

1)

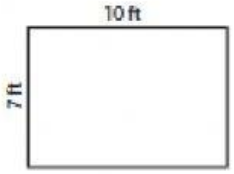

Area = ( )

2)



Area = ( )

3)



Area = ( )

4)



Area = ( )

5)

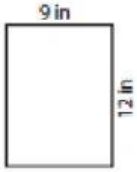

Area = ( )

6)

Area = ( )

7)



Area = ( )

8)

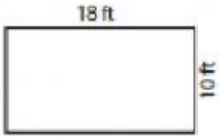

Area = ( )

9)

Area = ( )

LIVEWORKSHEETS