HOLY HEARTS SCHOOL
VARANASI

Fill in the blanks

Before	Between	After
◯ ← 3	1 ◯ 3	5 → ◯
◯ ← 6	6 ◯ 8	9 → ◯
◯ ← 2	8 ◯ 10	7 → ◯
◯ ← 8	3 ◯ 5	2 → ◯
◯ ← 10	7 ◯ 9	8 → ◯
◯ ← 5	4 ◯ 6	1 → ◯

Before	Between	After
◯ ← 54	77 ◯ 79	49 → ◯
◯ ← 67	48 ◯ 50	20 → ◯
◯ ← 82	60 ◯ 62	71 → ◯
◯ ← 79	83 ◯ 85	99 → ◯
◯ ← 38	19 ◯ 21	44 → ◯
◯ ← 90	56 ◯ 58	67 → ◯

Before and After

Write the numbers which comes before and after the given numbers.



MATHSDIARY.com

Increasing Order

Number the things in each set in an increasing order according to their size.

MATHSDIARY.com

Decreasing Order – Number the trees in decreasing order (Biggest to Smallest)



Odd One Out

Circle the odd one out in each of the given sets of pictures.